Opérations sur Une Droite Graduée (F)

Utlisez la droite graduée pour calculer chaque somme ou différence.

1. $110 + 10 =$ _____

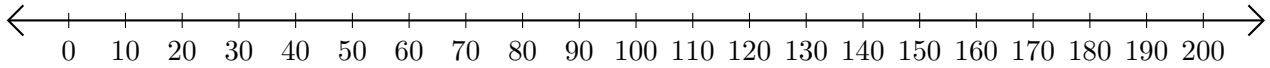

2. $200 - 150 =$ ____

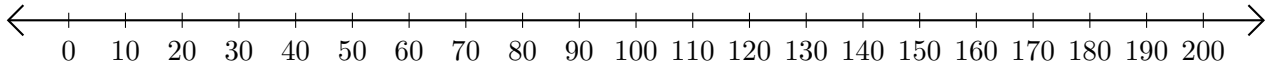

3. $30 + 170 =$ _____

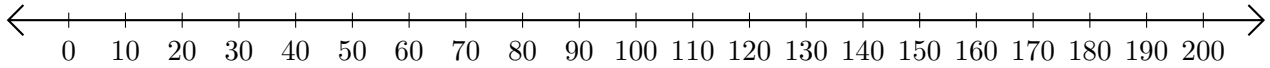

4. $80 - 10 =$ ____

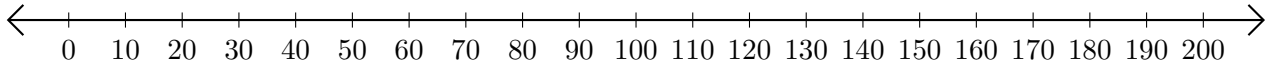
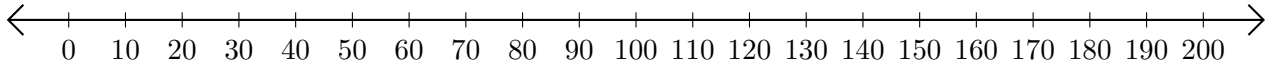
5. $50 + 40 =$ ____