Opérations sur Une Droite Graduée (E)

Utlisez la droite graduée pour calculer chaque somme ou différence.

1. $10 + 100 =$ _____

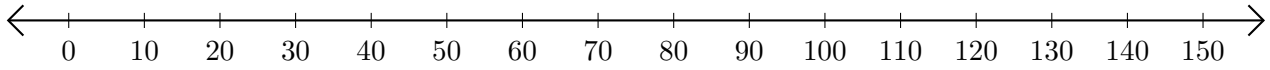

2. $90 - 60 =$ ____

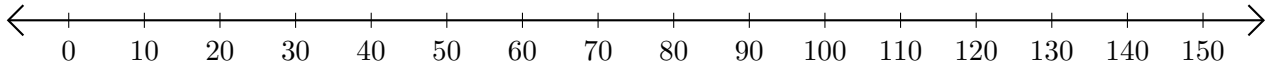

3. $30 + 110 =$ _____

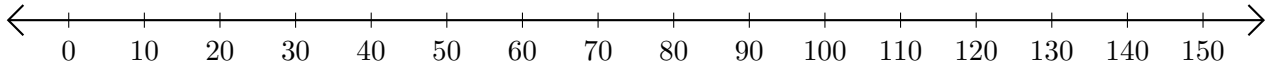

4. $150 - 110 =$ ____

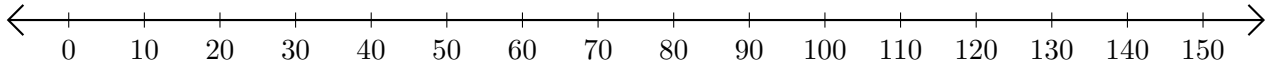
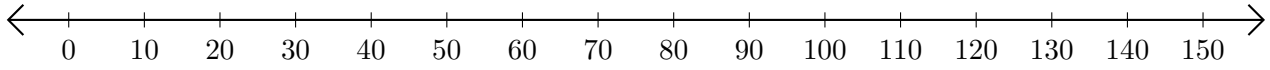
5. $40 + 50 =$ ____