Opérations sur Une Droite Graduée (C)

Utlisez la droite graduée pour calculer chaque somme ou différence.

1. $10 + 90 =$ _____

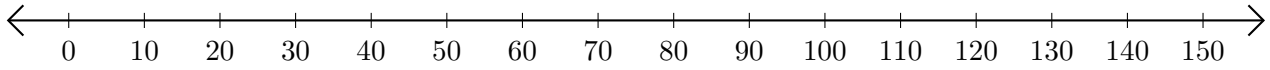

2. $150 - 140 =$ ____

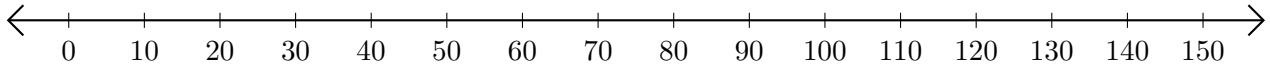

3. $120 + 20 =$ _____

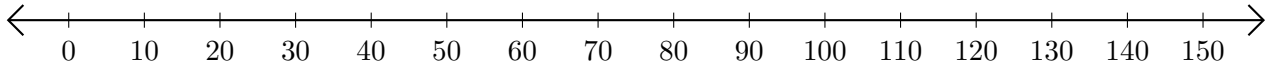

4. $100 - 70 =$ ____

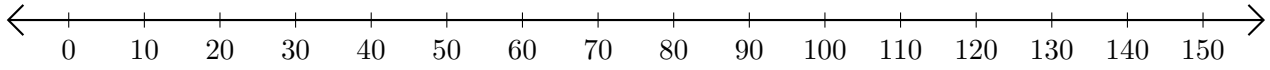
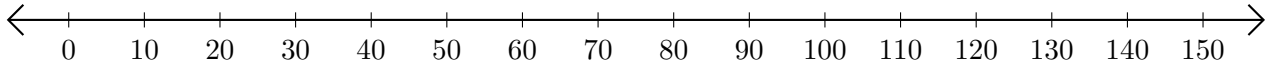
5. $130 - 90 =$ ____