Opérations sur Une Droite Graduée (B)

Utlisez la droite graduée pour calculer chaque somme ou différence.

1. $20 + 120 =$ _____

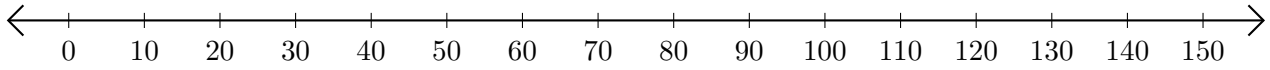

2. $150 - 140 =$ ____

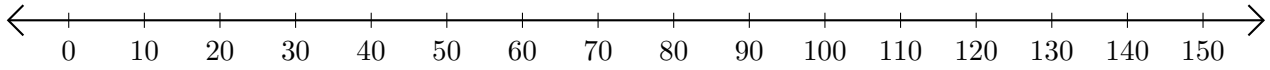

3. $10 + 40 =$ ____

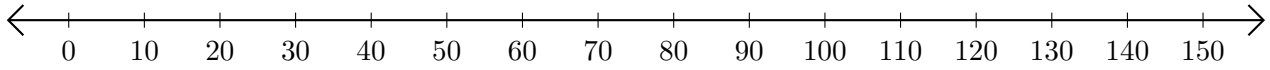

4. $140 - 70 =$ ____

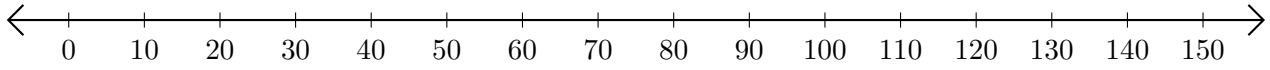
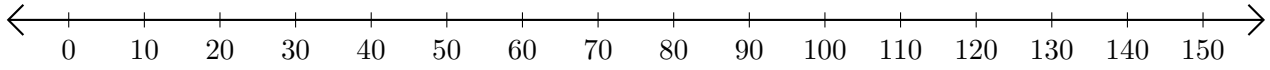
5. $130 - 80 =$ ____