Opérations sur Une Droite Graduée (J)

Utlisez la droite graduée pour calculer chaque somme ou différence.

1. $6 + 4 =$ ____

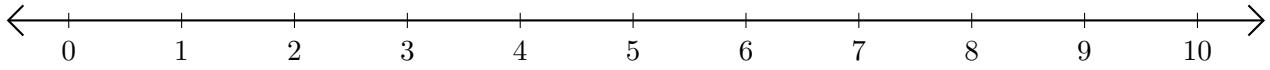

2. $10 - 9 =$ ___

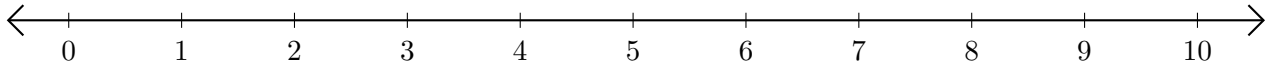

3. $3 + 3 =$ ___

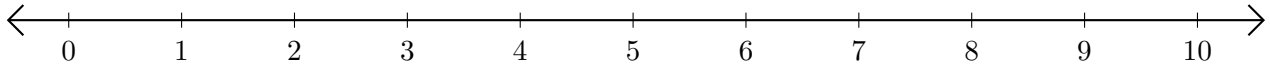

4. $3 - 2 =$ ___

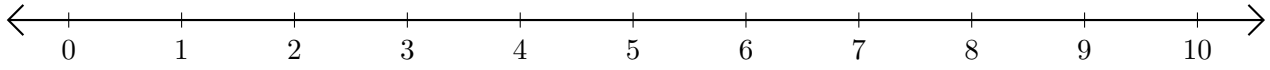
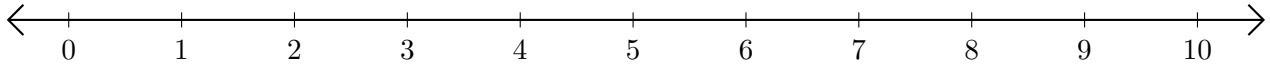
5. $10 - 5 =$ ___