Opérations sur Une Droite Graduée (I)

Utlisez la droite graduée pour calculer chaque somme ou différence.

1. $6 + 1 =$ ___

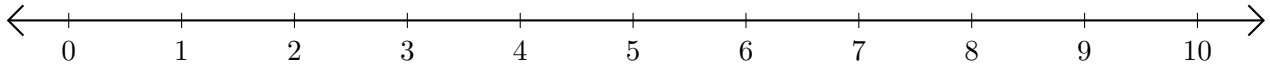

2. $10 - 9 =$ ___

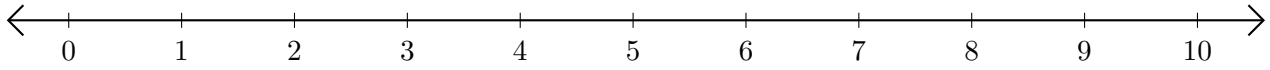

3. $2 + 7 =$ ___

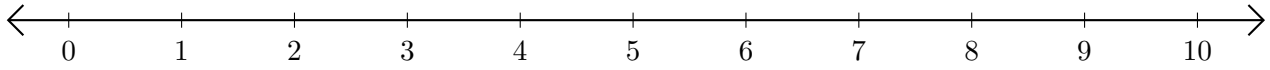

4. $9 - 1 =$ ___

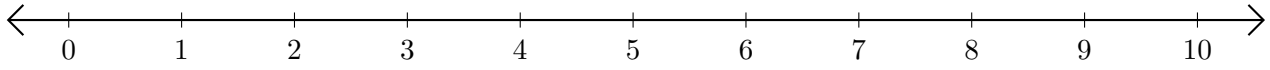
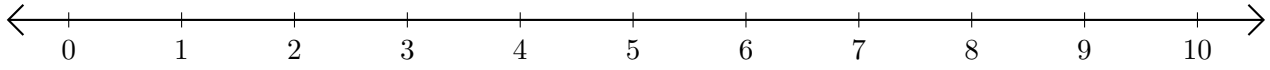
5. $7 + 2 =$ ___