Opérations sur Une Droite Graduée (H)

Utlisez la droite graduée pour calculer chaque somme ou différence.

1. $4 + 3 =$ ___

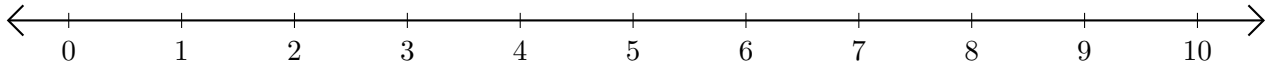

2. $6 - 5 =$ ___

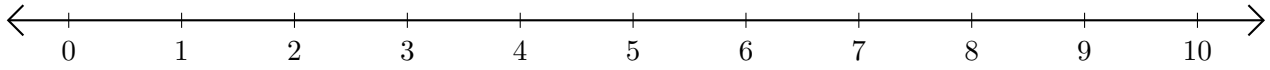

3. $6 + 4 =$ ____

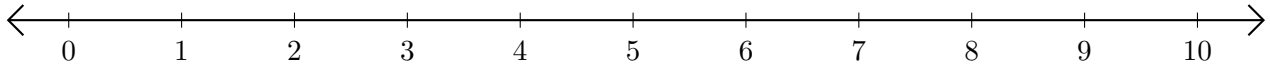

4. $10 - 8 =$ ___

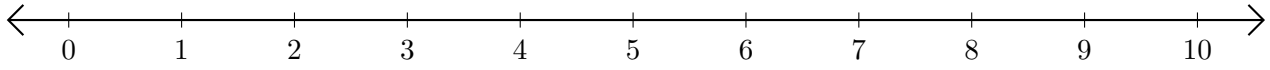
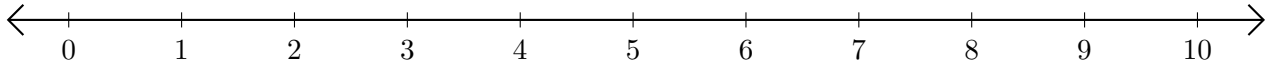
5. $6 - 2 =$ ___