Opérations sur Une Droite Graduée (G)

Utlisez la droite graduée pour calculer chaque somme ou différence.

1. $1 + 2 =$ ___

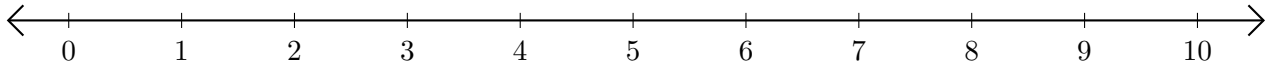

2. $10 - 8 =$ ___

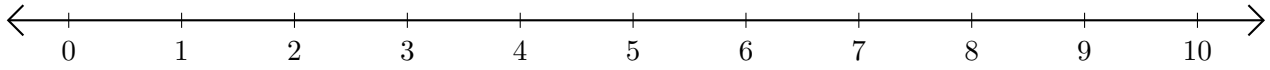

3. $5 + 5 =$ ____

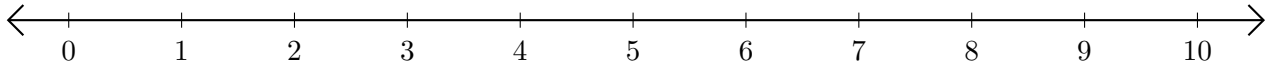

4. $10 - 7 =$ ___

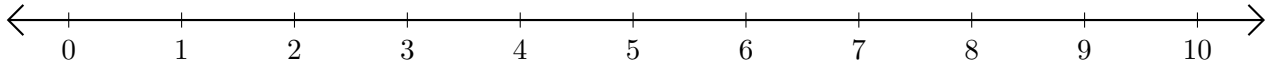

5. $8 - 6 =$ ___

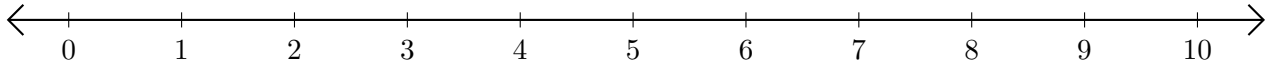

Opérations sur Une Droite Graduée (G) Réponses

Utlisez la droite graduée pour calculer chaque somme ou différence.

1. $1 + 2 =$ 3

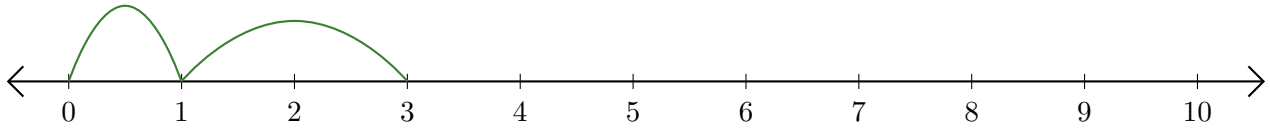

2. $10 - 8 =$ 2

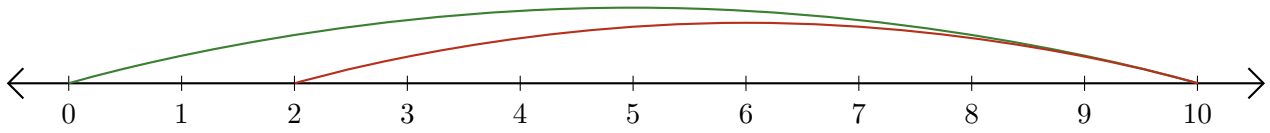

3. $5 + 5 =$ 10

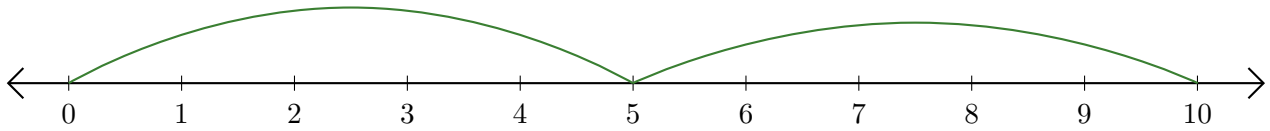

4. $10 - 7 =$ 3

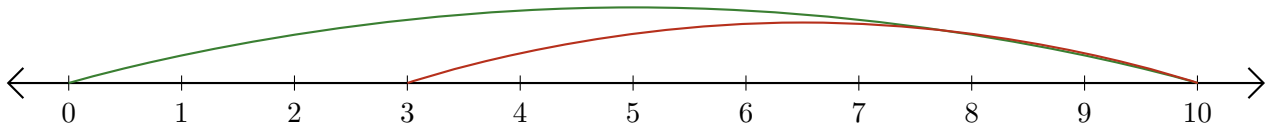
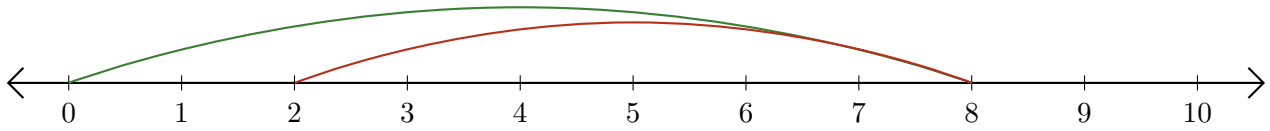
5. $8 - 6 =$ 2