Opérations sur Une Droite Graduée (E)

Utlisez la droite graduée pour calculer chaque somme ou différence.

1. $9 + 1 =$ ____

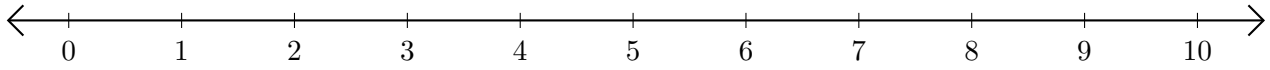

2. $5 - 1 =$ ___

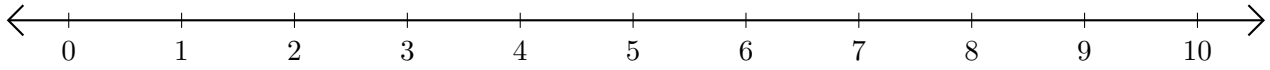

3. $2 + 4 =$ ___

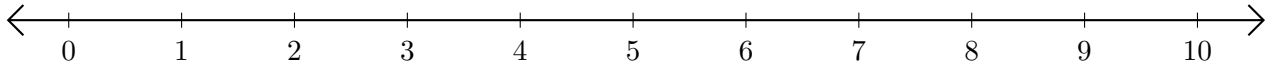

4. $10 - 6 =$ ___

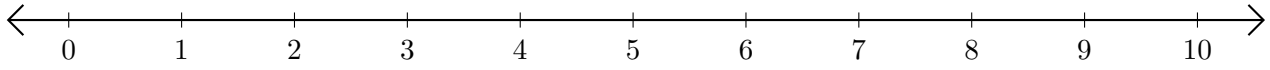
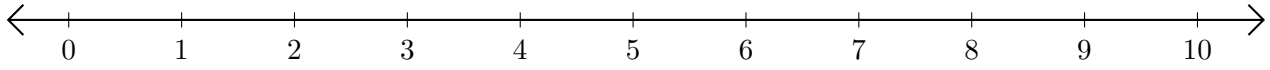
5. $4 - 3 =$ ___