Opérations sur Une Droite Graduée (D)

Utlisez la droite graduée pour calculer chaque somme ou différence.

1. $3 + 6 =$ ___

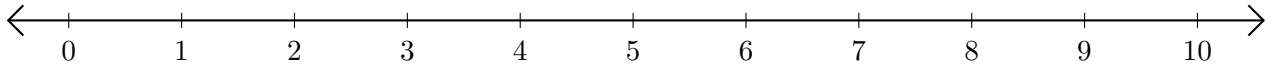

2. $7 - 6 =$ ___

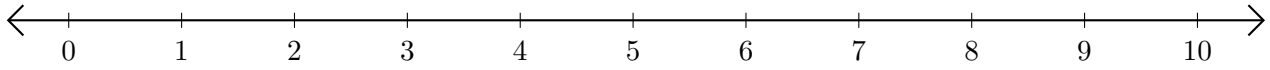

3. $8 + 1 =$ ___

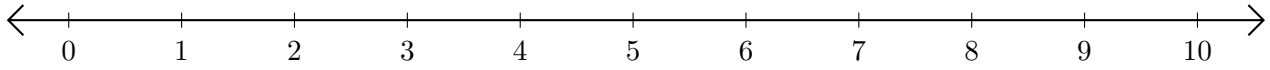

4. $10 - 9 =$ ___

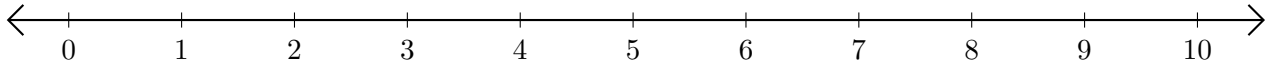
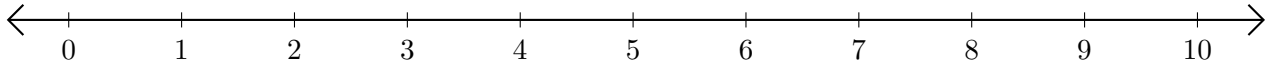
5. $7 + 1 =$ ___