Opérations sur Une Droite Graduée (B)

Utlisez la droite graduée pour calculer chaque somme ou différence.

1. $3 + 2 =$ ___

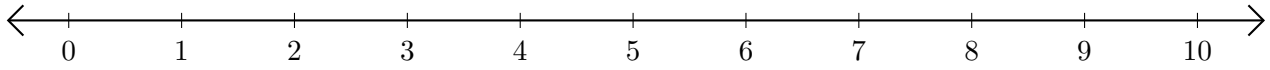

2. $10 - 2 =$ ___

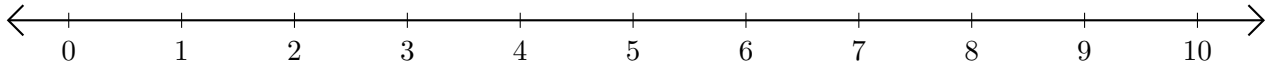

3. $6 + 2 =$ ___

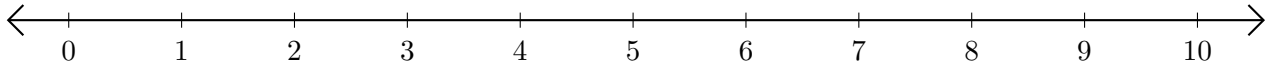

4. $8 - 4 =$ ___

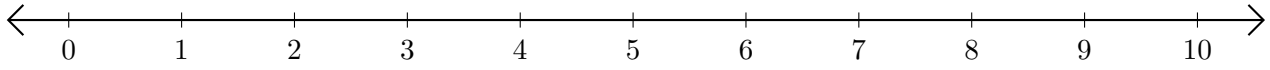

5. $3 - 1 =$ ___

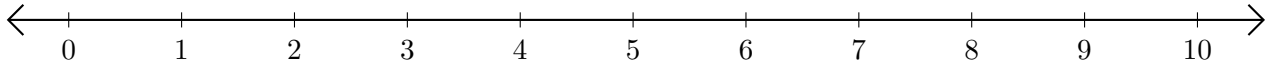

Opérations sur Une Droite Graduée (B) Réponses

Utlisez la droite graduée pour calculer chaque somme ou différence.

1. $3 + 2 =$ 5

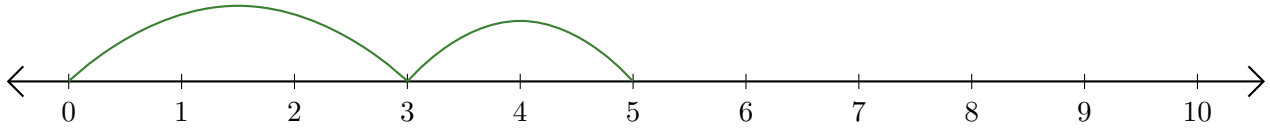

2. $10 - 2 =$ 8

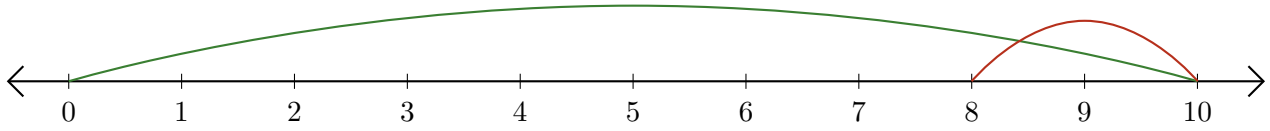

3. $6 + 2 =$ 8

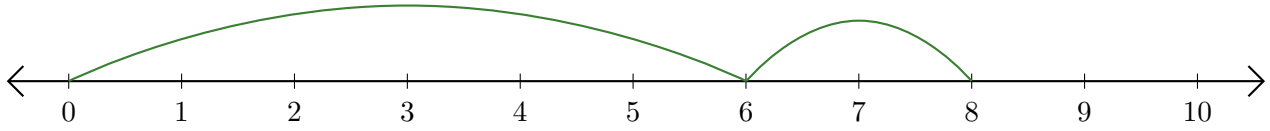

4. $8 - 4 =$ 4

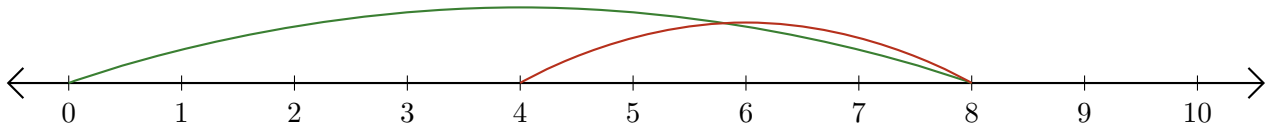
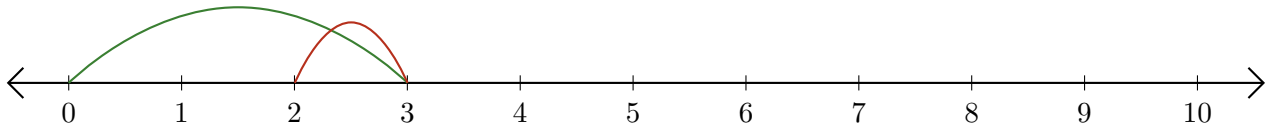
5. $3 - 1 =$ 2