# Opérations sur Une Droite Graduée (J)

Utlisez la droite graduée pour calculer chaque somme ou différence.

1. $10 + 30 =$ ____

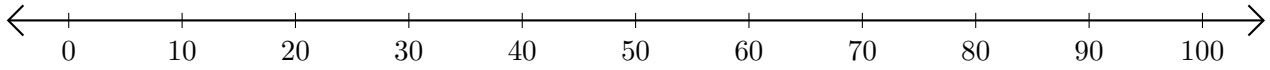


2. $70 - 40 =$ ____

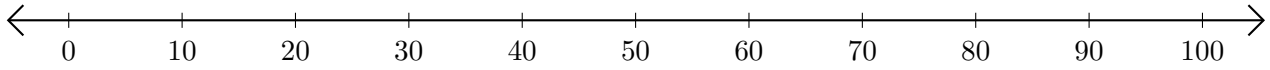


3. $80 + 10 =$ ____

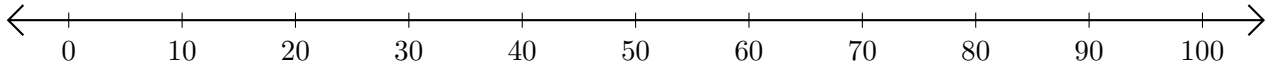


4. $100 - 90 =$ ____

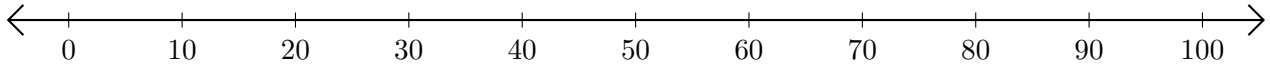

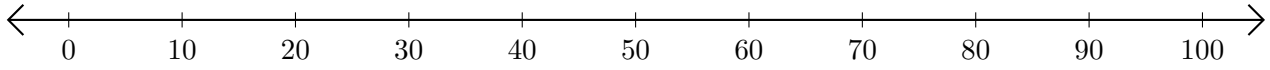
5. $100 - 60 =$ ____