Opérations sur Une Droite Graduée (F)

Utlisez la droite graduée pour calculer chaque somme ou différence.

1. $10 + 15 =$ ____

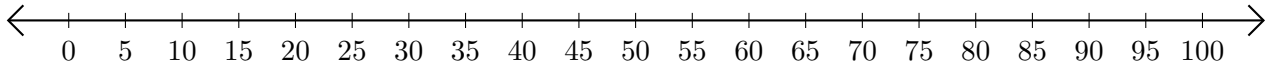

2. $100 - 35 =$ ____

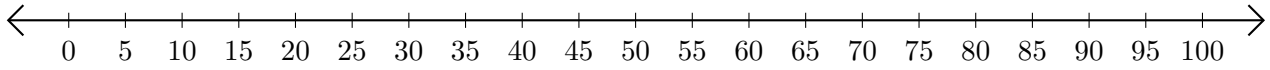

3. $90 + 5 =$ ____

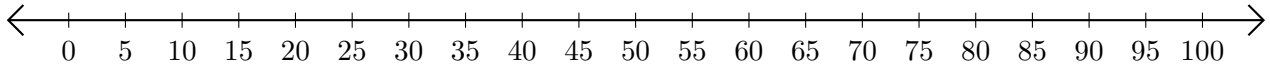

4. $95 - 85 =$ ____

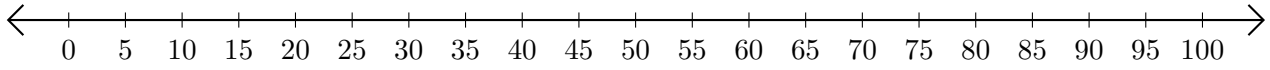
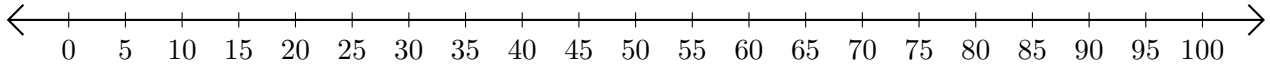
5. $50 + 35 =$ ____