Opérations sur Une Droite Graduée (C)

Utlisez la droite graduée pour calculer chaque somme ou différence.

1. $45 + 5 =$ ____

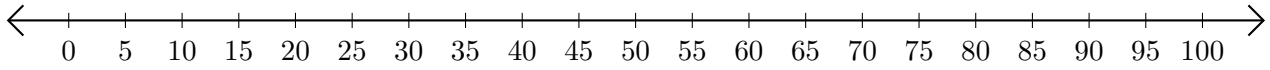

2. $70 - 15 =$ ____

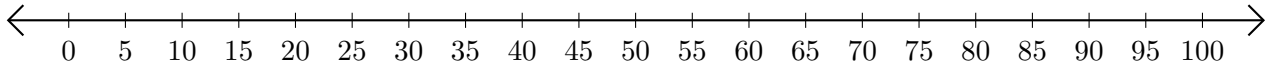

3. $30 + 5 =$ ____

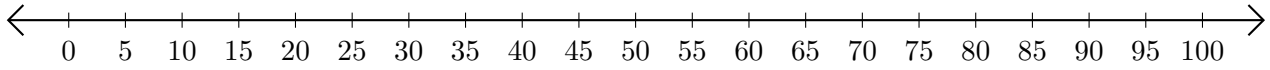

4. $80 - 65 =$ ____

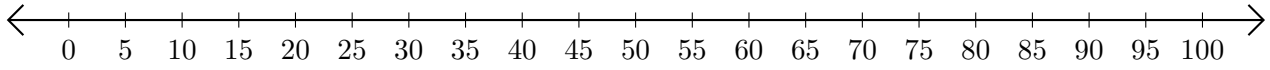
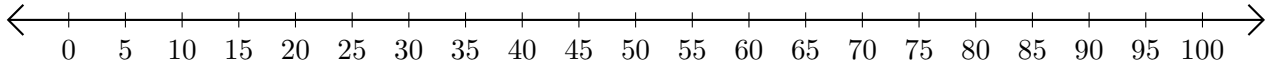
5. $95 - 25 =$ ____