Opérations sur Une Droite Graduée (C)

Utlisez la droite graduée pour calculer chaque somme ou différence.

1. $45 + 5 =$ ____

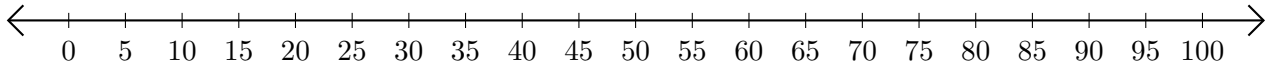

2. $70 - 15 =$ ____

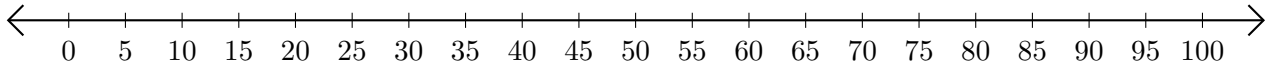

3. $30 + 5 =$ ____

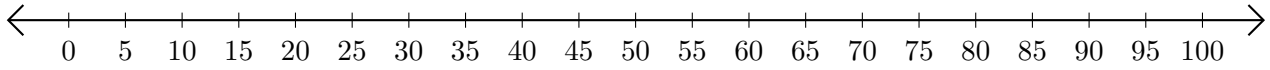

4. $80 - 65 =$ ____

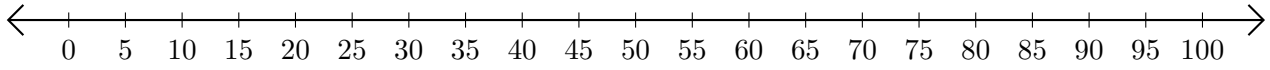

5. $95 - 25 =$ ____

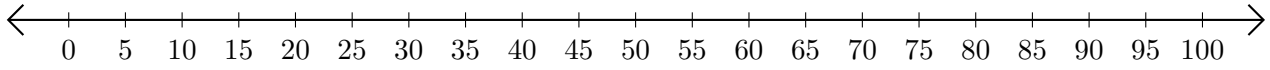

Opérations sur Une Droite Graduée (C) Réponses

Utlisez la droite graduée pour calculer chaque somme ou différence.

1. $45 + 5 =$ 50

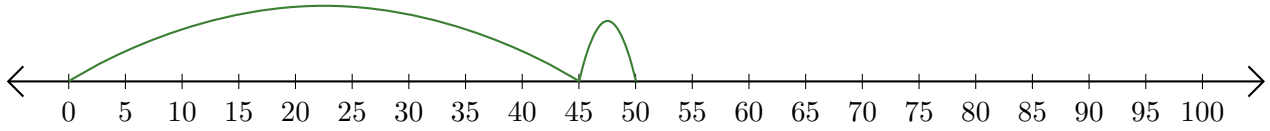

2. $70 - 15 =$ 55

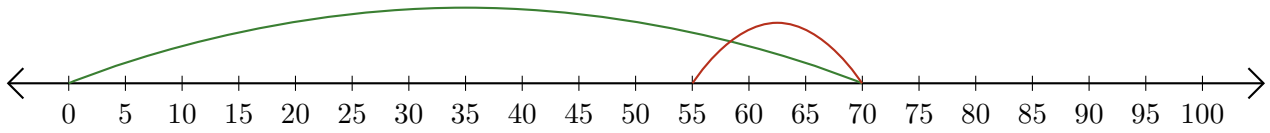

3. $30 + 5 =$ 35

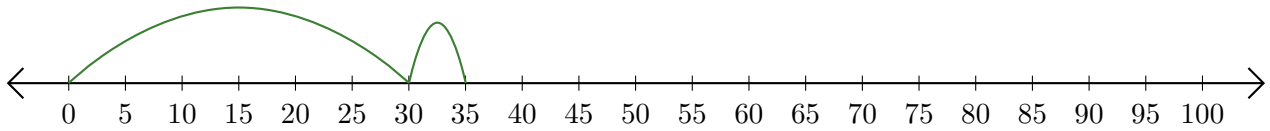

4. $80 - 65 =$ 15

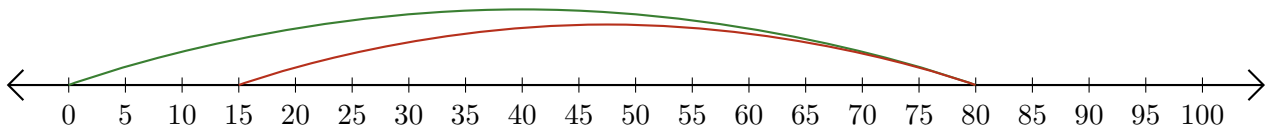
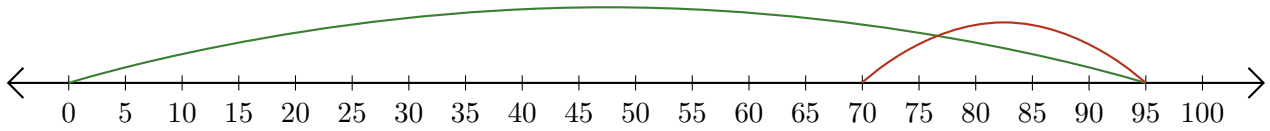
5. $95 - 25 =$ 70