Opérations sur Une Droite Graduée (B)

Utlisez la droite graduée pour calculer chaque somme ou différence.

1. $80 + 15 =$ ____

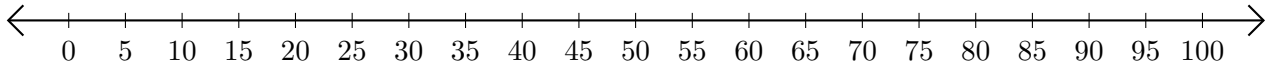

2. $90 - 50 =$ ____

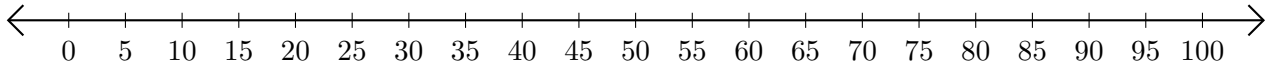

3. $25 + 40 =$ ____

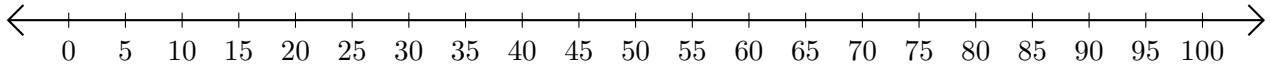

4. $95 - 15 =$ ____

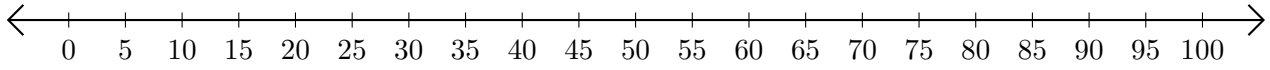
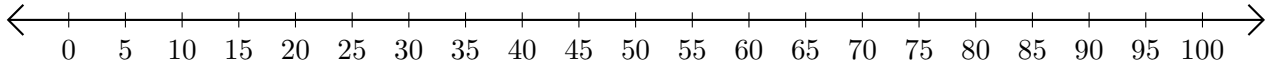
5. $55 + 15 =$ ____