Facteurs Premiers (A)

Utilisez un diagramme à branches pour trouver les facteurs premiers des nombres suivants.

62

36

144

78

135

55

70

16

78

Facteurs Premiers (A) Solutions

Utilisez un diagramme à branches pour trouver les facteurs premiers des nombres suivants.

62

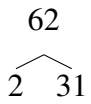

$62 = 2 \times 31$

36

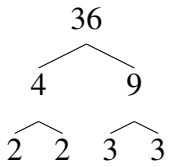

$36 = 2^2 \times 3^2$

144

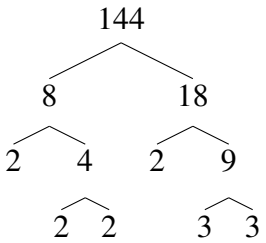

$144 = 2^4 \times 3^2$

78

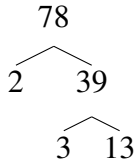

$78 = 2 \times 3 \times 13$

135

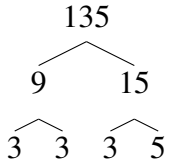

$135 = 3^3 \times 5$

55

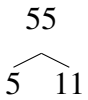

$55 = 5 \times 11$

70

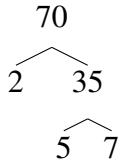

$70 = 2 \times 5 \times 7$

16

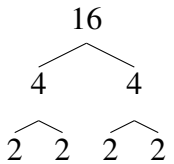

$16 = 2^4$

78

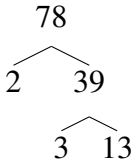

$78 = 2 \times 3 \times 13$

Facteurs Premiers (B)

Utilisez un diagramme à branches pour trouver les facteurs premiers des nombres suivants.

80

125

133

115

88

88

98

62

117

Facteurs Premiers (B) Solutions

Utilisez un diagramme à branches pour trouver les facteurs premiers des nombres suivants.

80

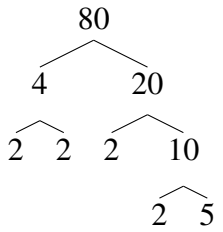

$80 = 2^4 \times 5$

125

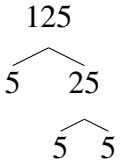

$125 = 5^3$

133

$133 = 7 \times 19$

115

$115 = 5 \times 23$

88

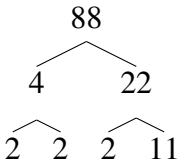

$88 = 2^3 \times 11$

88

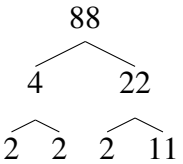

$88 = 2^3 \times 11$

98

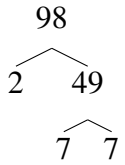

$98 = 2 \times 7^2$

62

$62 = 2 \times 31$

117

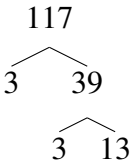

$117 = 3^2 \times 13$

Facteurs Premiers (C)

Utilisez un diagramme à branches pour trouver les facteurs premiers des nombres suivants.

105 82 69

126 125 85

118 56 25

Facteurs Premiers (C) Solutions

Utilisez un diagramme à branches pour trouver les facteurs premiers des nombres suivants.

105

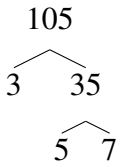

$105 = 3 \times 5 \times 7$

82

$82 = 2 \times 41$

69

$69 = 3 \times 23$

126

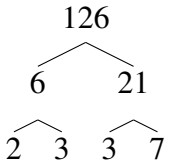

$126 = 2 \times 3^2 \times 7$

125

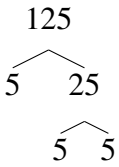

$125 = 5^3$

85

$85 = 5 \times 17$

118

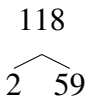

$118 = 2 \times 59$

56

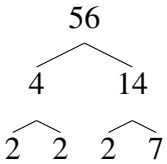

$56 = 2^3 \times 7$

25

$25 = 5^2$

Facteurs Premiers (D)

Utilisez un diagramme à branches pour trouver les facteurs premiers des nombres suivants.

87

24

108

44

22

135

116

55

27

Facteurs Premiers (D) Solutions

Utilisez un diagramme à branches pour trouver les facteurs premiers des nombres suivants.

87

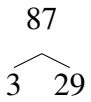

$87 = 3 \times 29$

24

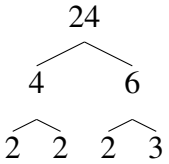

$24 = 2^3 \times 3$

108

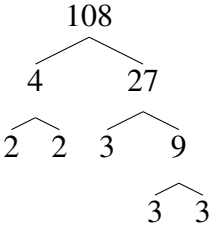

$108 = 2^2 \times 3^3$

44

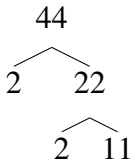

$44 = 2^2 \times 11$

22

$22 = 2 \times 11$

135

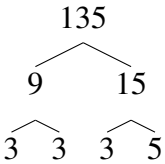

$135 = 3^3 \times 5$

116

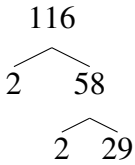

$116 = 2^2 \times 29$

55

$55 = 5 \times 11$

27

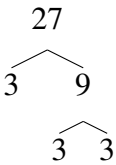

$27 = 3^3$

Facteurs Premiers (E)

Utilisez un diagramme à branches pour trouver les facteurs premiers des nombres suivants.

91

38

102

85

39

22

138

77

129

Facteurs Premiers (E) Solutions

Utilisez un diagramme à branches pour trouver les facteurs premiers des nombres suivants.

91

91

7 13

$91 = 7 \times 13$

38

38

2 19

$38 = 2 \times 19$

102

102

2 51

3 17

$102 = 2 \times 3 \times 17$

85

85

5 17

$85 = 5 \times 17$

39

39

3 13

$39 = 3 \times 13$

22

22

2 11

$22 = 2 \times 11$

138

138

2 69

3 23

$138 = 2 \times 3 \times 23$

77

77

7 11

$77 = 7 \times 11$

129

129

3 43

$129 = 3 \times 43$

Facteurs Premiers (F)

Utilisez un diagramme à branches pour trouver les facteurs premiers des nombres suivants.

130

88

98

125

85

140

4

123

33

Facteurs Premiers (F) Solutions

Utilisez un diagramme à branches pour trouver les facteurs premiers des nombres suivants.

130

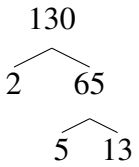

$130 = 2 \times 5 \times 13$

88

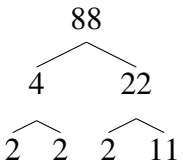

$88 = 2^3 \times 11$

98

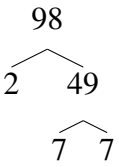

$98 = 2 \times 7^2$

125

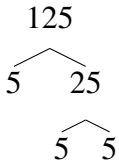

$125 = 5^3$

85

$85 = 5 \times 17$

140

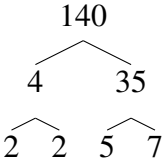

$140 = 2^2 \times 5 \times 7$

4



$4 = 2^2$

123

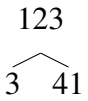

$123 = 3 \times 41$

33

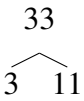

$33 = 3 \times 11$

Facteurs Premiers (G)

Utilisez un diagramme à branches pour trouver les facteurs premiers des nombres suivants.

34

70

62

130

105

95

27

112

74

Facteurs Premiers (G) Solutions

Utilisez un diagramme à branches pour trouver les facteurs premiers des nombres suivants.

34

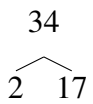

$34 = 2 \times 17$

70

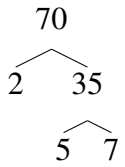

$70 = 2 \times 5 \times 7$

62

$62 = 2 \times 31$

130

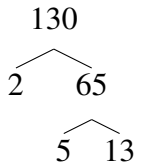

$130 = 2 \times 5 \times 13$

105

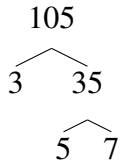

$105 = 3 \times 5 \times 7$

95

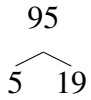

$95 = 5 \times 19$

27

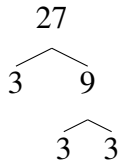

$27 = 3^3$

112

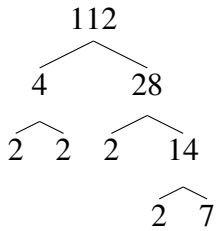

$112 = 2^4 \times 7$

74

$74 = 2 \times 37$

Facteurs Premiers (H)

Utilisez un diagramme à branches pour trouver les facteurs premiers des nombres suivants.

114 69 96

130 114 108

140 6 80

Facteurs Premiers (H) Solutions

Utilisez un diagramme à branches pour trouver les facteurs premiers des nombres suivants.

114

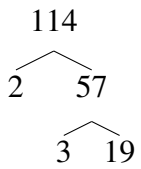

$114 = 2 \times 3 \times 19$

69

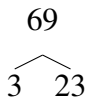

$69 = 3 \times 23$

96

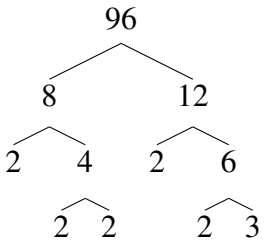

$96 = 2^5 \times 3$

130

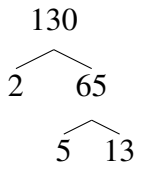

$130 = 2 \times 5 \times 13$

114

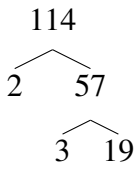

$114 = 2 \times 3 \times 19$

108

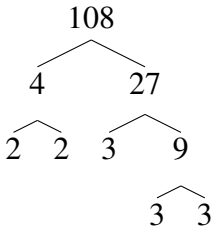

$108 = 2^2 \times 3^3$

140

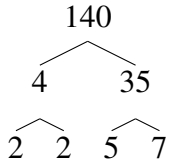

$140 = 2^2 \times 5 \times 7$

6

$6 = 2 \times 3$

80

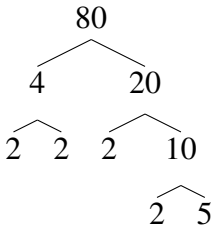

$80 = 2^4 \times 5$

Facteurs Premiers (I)

Utilisez un diagramme à branches pour trouver les facteurs premiers des nombres suivants.

102

16

58

20

56

119

50

81

121

Facteurs Premiers (I) Solutions

Utilisez un diagramme à branches pour trouver les facteurs premiers des nombres suivants.

102

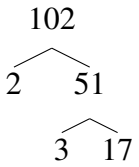

$102 = 2 \times 3 \times 17$

16

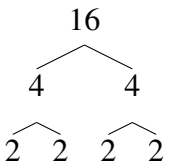

$16 = 2^4$

58

$58 = 2 \times 29$

20

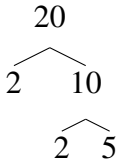

$20 = 2^2 \times 5$

56

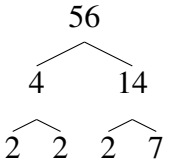

$56 = 2^3 \times 7$

119

$119 = 7 \times 17$

50

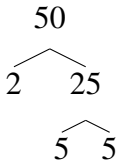

$50 = 2 \times 5^2$

81

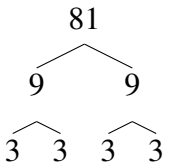

$81 = 3^4$

121

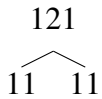

$121 = 11^2$

Facteurs Premiers (J)

Utilisez un diagramme à branches pour trouver les facteurs premiers des nombres suivants.

38

121

76

121

129

133

33

36

24

Facteurs Premiers (J) Solutions

Utilisez un diagramme à branches pour trouver les facteurs premiers des nombres suivants.

38

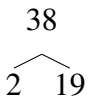

$38 = 2 \times 19$

121

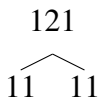

$121 = 11^2$

76

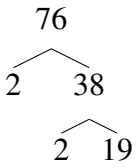

$76 = 2^2 \times 19$

121

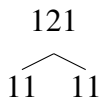

$121 = 11^2$

129

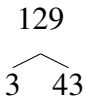

$129 = 3 \times 43$

133

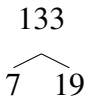

$133 = 7 \times 19$

33

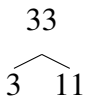

$33 = 3 \times 11$

36

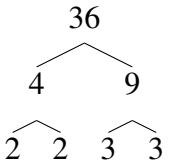

$36 = 2^2 \times 3^2$

24

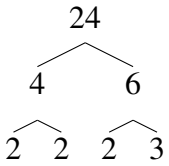

$24 = 2^3 \times 3$