Facteurs Premiers (A)

Utilisez un diagramme à branches pour trouver les facteurs premiers des nombres suivants.

84 90 94

75 77 9

20 15 16

Facteurs Premiers (A) Solutions

Utilisez un diagramme à branches pour trouver les facteurs premiers des nombres suivants.

84

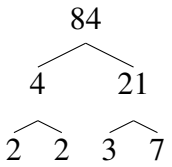

$84 = 2^2 \times 3 \times 7$

90

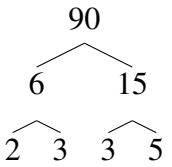

$90 = 2 \times 3^2 \times 5$

94

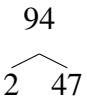

$94 = 2 \times 47$

75

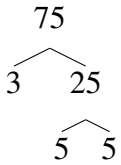

$75 = 3 \times 5^2$

77

$77 = 7 \times 11$

9

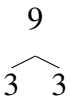

$9 = 3^2$

20

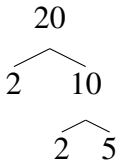

$20 = 2^2 \times 5$

15

$15 = 3 \times 5$

16

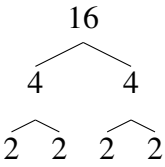

$16 = 2^4$

Facteurs Premiers (B)

Utilisez un diagramme à branches pour trouver les facteurs premiers des nombres suivants.

70 18 46

78 39 50

12 88 24

Facteurs Premiers (B) Solutions

Utilisez un diagramme à branches pour trouver les facteurs premiers des nombres suivants.

70

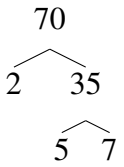

$70 = 2 \times 5 \times 7$

18

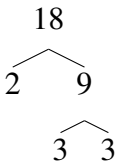

$18 = 2 \times 3^2$

46

$46 = 2 \times 23$

78

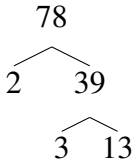

$78 = 2 \times 3 \times 13$

39

$39 = 3 \times 13$

50

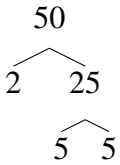

$50 = 2 \times 5^2$

12

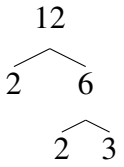

$12 = 2^2 \times 3$

88

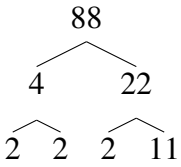

$88 = 2^3 \times 11$

24

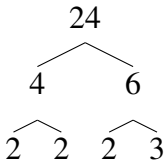

$24 = 2^3 \times 3$

Facteurs Premiers (C)

Utilisez un diagramme à branches pour trouver les facteurs premiers des nombres suivants.

40 20 45

93 54 66

16 33 36

Facteurs Premiers (C) Solutions

Utilisez un diagramme à branches pour trouver les facteurs premiers des nombres suivants.

40

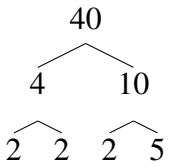

$40 = 2^3 \times 5$

20

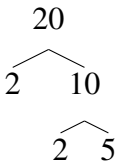

$20 = 2^2 \times 5$

45

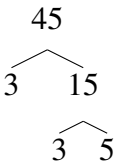

$45 = 3^2 \times 5$

93

$93 = 3 \times 31$

54

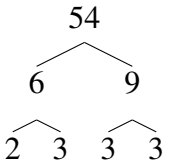

$54 = 2 \times 3^3$

66

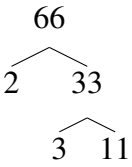

$66 = 2 \times 3 \times 11$

16

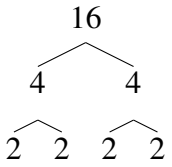

$16 = 2^4$

33

$33 = 3 \times 11$

36

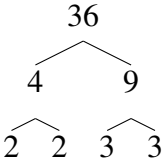

$36 = 2^2 \times 3^2$

Facteurs Premiers (D)

Utilisez un diagramme à branches pour trouver les facteurs premiers des nombres suivants.

46 84 91

14 95 91

88 35 40

Facteurs Premiers (D) Solutions

Utilisez un diagramme à branches pour trouver les facteurs premiers des nombres suivants.

46

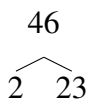

$46 = 2 \times 23$

84

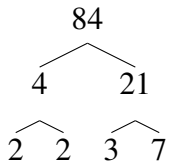

$84 = 2^2 \times 3 \times 7$

91

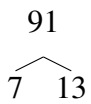

$91 = 7 \times 13$

14

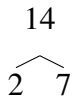

$14 = 2 \times 7$

95

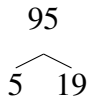

$95 = 5 \times 19$

91

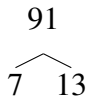

$91 = 7 \times 13$

88

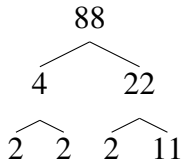

$88 = 2^3 \times 11$

35

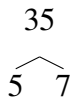

$35 = 5 \times 7$

40

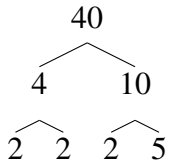

$40 = 2^3 \times 5$

Facteurs Premiers (E)

Utilisez un diagramme à branches pour trouver les facteurs premiers des nombres suivants.

63

81

15

65

95

76

46

21

27

Facteurs Premiers (E) Solutions

Utilisez un diagramme à branches pour trouver les facteurs premiers des nombres suivants.

63

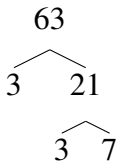

$63 = 3^2 \times 7$

81

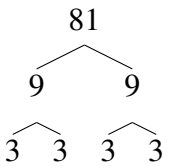

$81 = 3^4$

15

$15 = 3 \times 5$

65

$65 = 5 \times 13$

95

$95 = 5 \times 19$

76

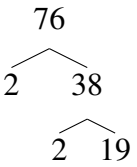

$76 = 2^2 \times 19$

46

$46 = 2 \times 23$

21

$21 = 3 \times 7$

27

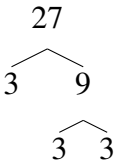

$27 = 3^3$

Facteurs Premiers (F)

Utilisez un diagramme à branches pour trouver les facteurs premiers des nombres suivants.

93

91

42

74

16

10

52

70

56

Facteurs Premiers (F) Solutions

Utilisez un diagramme à branches pour trouver les facteurs premiers des nombres suivants.

93

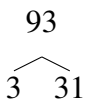

$93 = 3 \times 31$

91

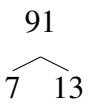

$91 = 7 \times 13$

42

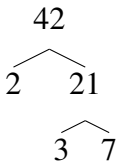

$42 = 2 \times 3 \times 7$

74

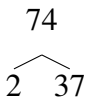

$74 = 2 \times 37$

16

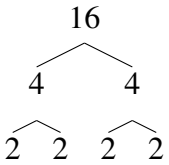

$16 = 2^4$

10

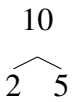

$10 = 2 \times 5$

52

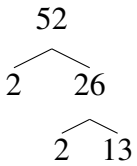

$52 = 2^2 \times 13$

70

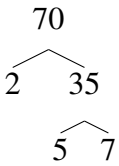

$70 = 2 \times 5 \times 7$

56

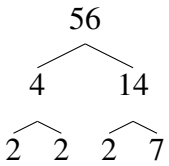

$56 = 2^3 \times 7$

Facteurs Premiers (G)

Utilisez un diagramme à branches pour trouver les facteurs premiers des nombres suivants.

74

74

50

63

46

66

18

95

56

Facteurs Premiers (G) Solutions

Utilisez un diagramme à branches pour trouver les facteurs premiers des nombres suivants.

74

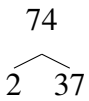

$74 = 2 \times 37$

74

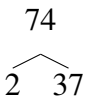

$74 = 2 \times 37$

50

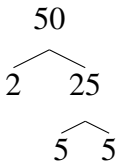

$50 = 2 \times 5^2$

63

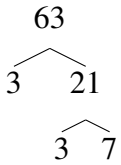

$63 = 3^2 \times 7$

46

$46 = 2 \times 23$

66

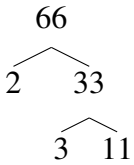

$66 = 2 \times 3 \times 11$

18

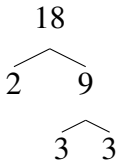

$18 = 2 \times 3^2$

95

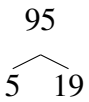

$95 = 5 \times 19$

56

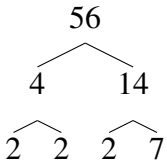

$56 = 2^3 \times 7$

Facteurs Premiers (H)

Utilisez un diagramme à branches pour trouver les facteurs premiers des nombres suivants.

63 34 78

66 54 93

27 70 14

Facteurs Premiers (H) Solutions

Utilisez un diagramme à branches pour trouver les facteurs premiers des nombres suivants.

63

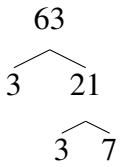

$63 = 3^2 \times 7$

34

$34 = 2 \times 17$

78

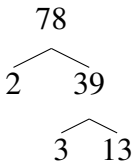

$78 = 2 \times 3 \times 13$

66

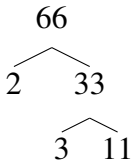

$66 = 2 \times 3 \times 11$

54

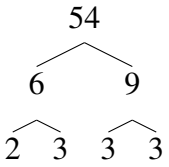

$54 = 2 \times 3^3$

93

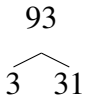

$93 = 3 \times 31$

27

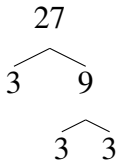

$27 = 3^3$

70

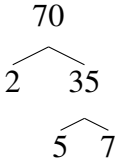

$70 = 2 \times 5 \times 7$

14

$14 = 2 \times 7$

Facteurs Premiers (I)

Utilisez un diagramme à branches pour trouver les facteurs premiers des nombres suivants.

95 36 74

50 57 70

88 4 64

Facteurs Premiers (I) Solutions

Utilisez un diagramme à branches pour trouver les facteurs premiers des nombres suivants.

95

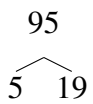

$95 = 5 \times 19$

36

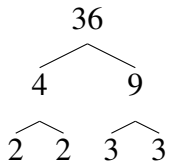

$36 = 2^2 \times 3^2$

74

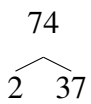

$74 = 2 \times 37$

50

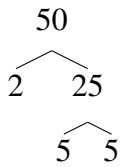

$50 = 2 \times 5^2$

57

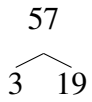

$57 = 3 \times 19$

70

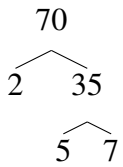

$70 = 2 \times 5 \times 7$

88

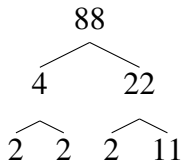

$88 = 2^3 \times 11$

4

$4 = 2^2$

64

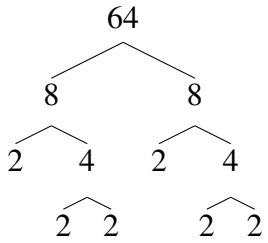

$64 = 2^6$

Facteurs Premiers (J)

Utilisez un diagramme à branches pour trouver les facteurs premiers des nombres suivants.

16 39 24

33 12 90

22 81 33

Facteurs Premiers (J) Solutions

Utilisez un diagramme à branches pour trouver les facteurs premiers des nombres suivants.

16

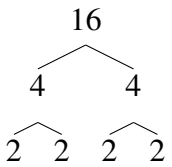

$16 = 2^4$

39

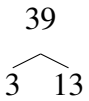

$39 = 3 \times 13$

24

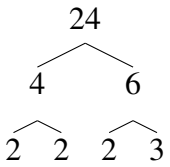

$24 = 2^3 \times 3$

33

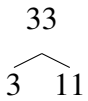

$33 = 3 \times 11$

12

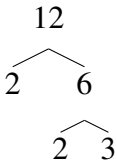

$12 = 2^2 \times 3$

90

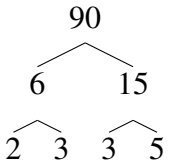

$90 = 2 \times 3^2 \times 5$

22

$22 = 2 \times 11$

81

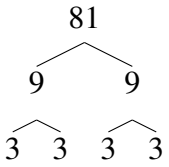

$81 = 3^4$

33

$33 = 3 \times 11$