Facteurs Premiers (I)

Utilisez un diagramme à branches pour trouver les facteurs premiers des nombres suivants.

6	14	14
27	44	9
22	40	4

Facteurs Premiers (I) Solutions

Utilisez un diagramme à branches pour trouver les facteurs premiers des nombres suivants.

6

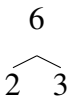

$6 = 2 \times 3$

14

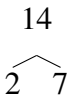

$14 = 2 \times 7$

14

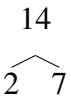

$14 = 2 \times 7$

27

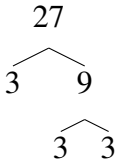

$27 = 3^3$

44

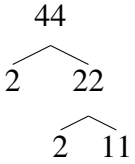

$44 = 2^2 \times 11$

9

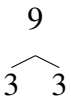

$9 = 3^2$

22

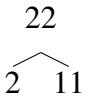

$22 = 2 \times 11$

40

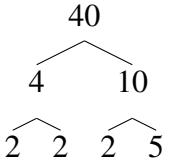

$40 = 2^3 \times 5$

4



$4 = 2^2$