Méthode de Multiplication par Treillis (D)

Utilisez la méthode de multiplication par treillis pour trouver chaque produit.

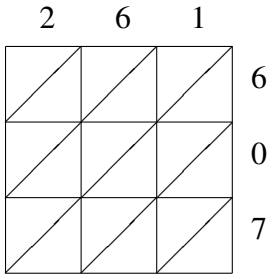

$261 \times 607 =$ _____

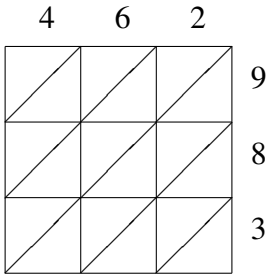

$462 \times 983 =$ _____

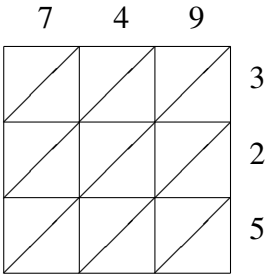

$749 \times 325 =$ _____

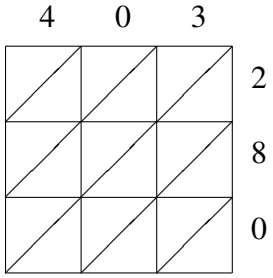

$403 \times 280 =$ _____

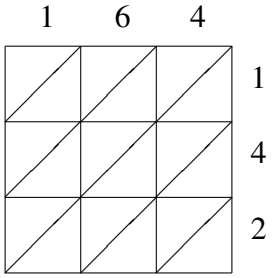

$164 \times 142 =$ _____

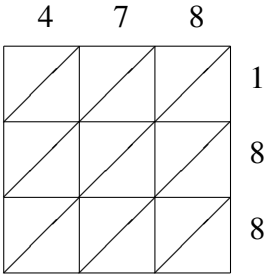

$478 \times 188 =$ _____

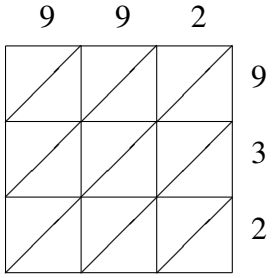

$992 \times 932 =$ _____

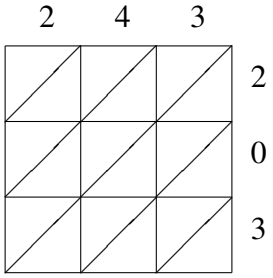

$243 \times 203 =$ _____

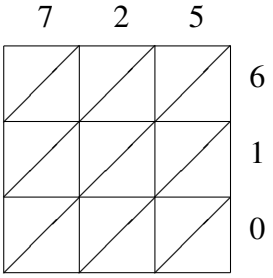

$725 \times 610 =$ _____