Méthode de Multiplication par Treillis (C)

Utilisez la méthode de multiplication par treillis pour trouver chaque produit.

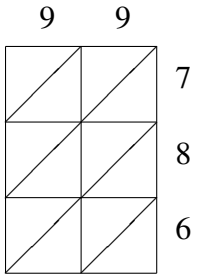

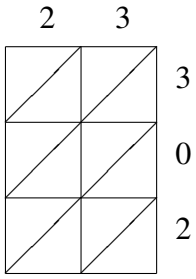

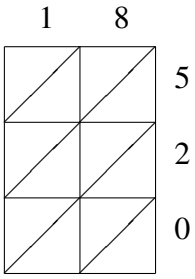

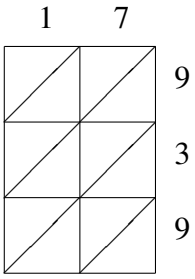

$99 \times 786 =$ _____ $23 \times 302 =$ _____ $18 \times 520 =$ _____ $17 \times 939 =$ _____

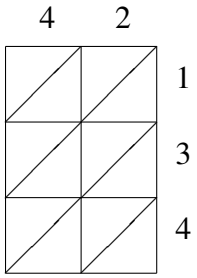

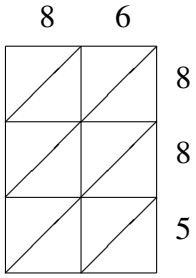

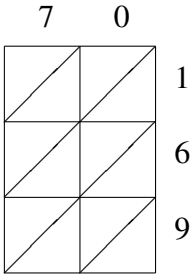

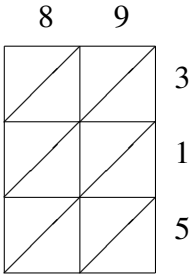

$42 \times 134 =$ _____ $86 \times 885 =$ _____ $70 \times 169 =$ _____ $89 \times 315 =$ _____

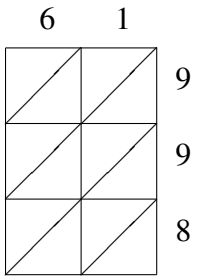

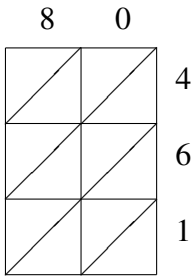

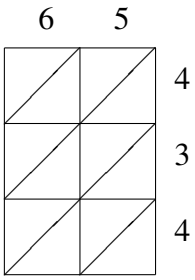

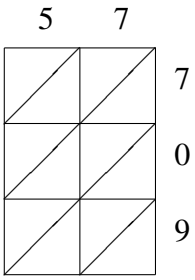

$61 \times 998 =$ _____ $80 \times 461 =$ _____ $65 \times 434 =$ _____ $57 \times 709 =$ _____