Méthode de Multiplication par Treillis (D)

Utilisez la méthode de multiplication par treillis pour trouver chaque produit.

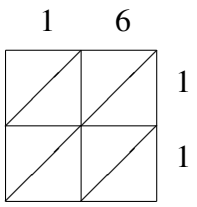

$16 \times 11 =$ ___

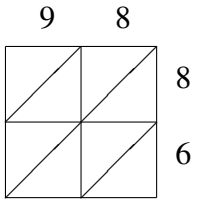

$98 \times 86 =$ _____

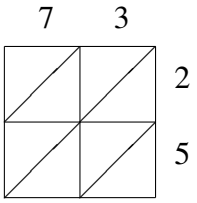

$73 \times 25 =$ _____

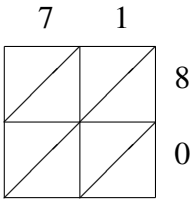

$71 \times 80 =$ _____

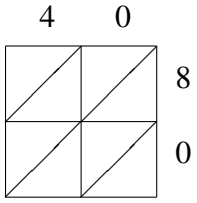

$40 \times 80 =$ _____

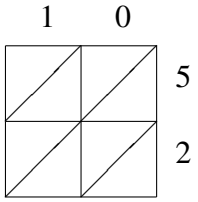

$10 \times 52 =$ ___

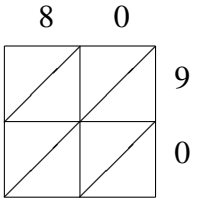

$80 \times 90 =$ _____

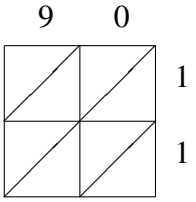

$90 \times 11 =$ ___

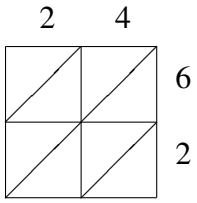

$24 \times 62 =$ _____

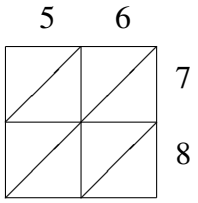

$56 \times 78 =$ _____

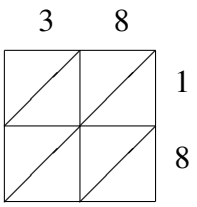

$38 \times 18 =$ ___

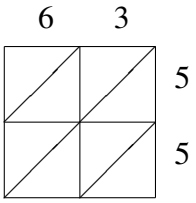

$63 \times 55 =$ _____

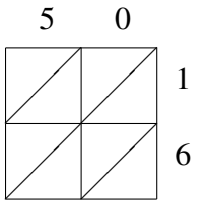

$50 \times 16 =$ ___

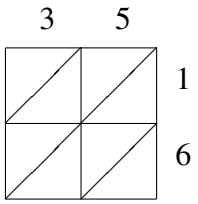

$35 \times 16 =$ ___

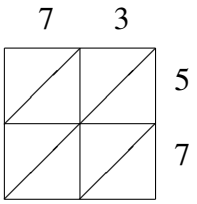

$73 \times 57 =$ _____

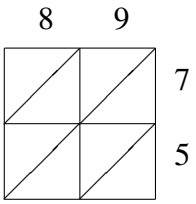

$89 \times 75 =$ _____