Lecture d'Horloge Analogue (A)

Lisez le temps indiqué et inscrivez le sous l'horloge.

1.
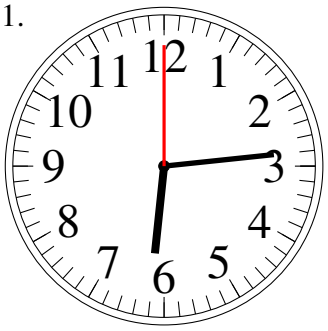

_____

2.
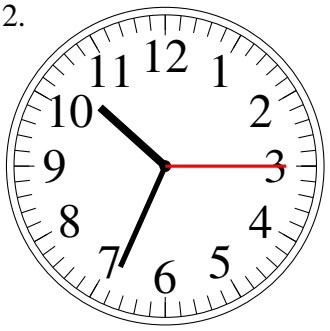

_____

3.
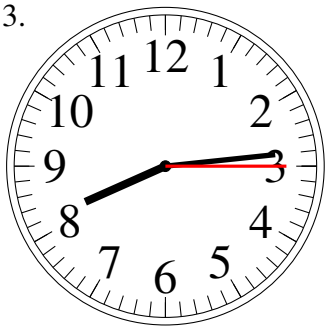

_____

4.
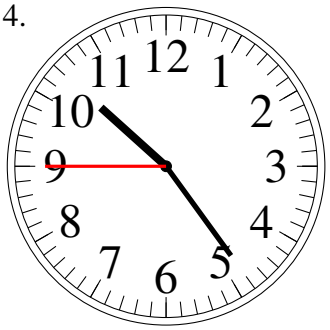

_____

5.
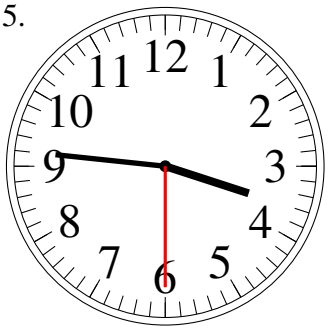

_____

6.
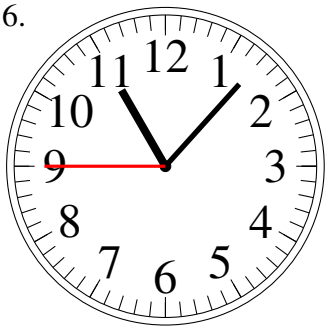

_____

7.


_____

8.
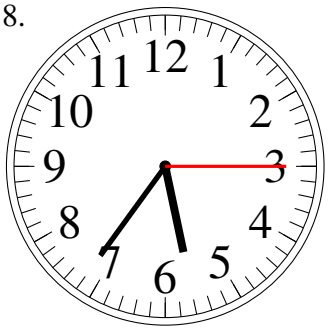

_____

9.


_____

10.


_____

11.
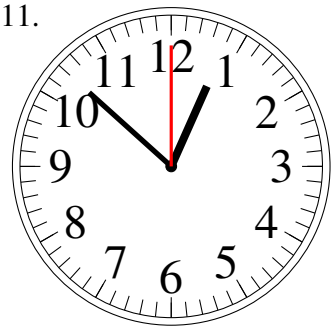

_____

12.
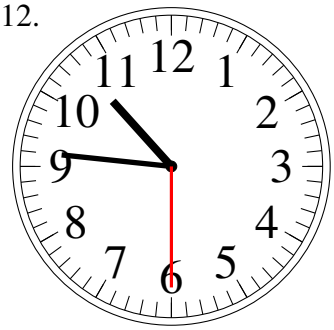

_____

Lecture d'Horloge Analogue (A) Solutions

Lisez le temps indiqué et inscrivez le sous l'horloge.

1.

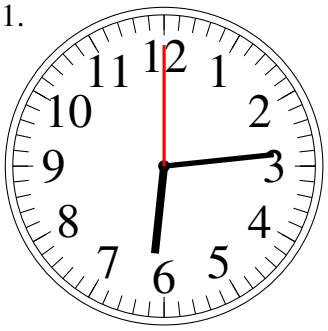

6:14.00

2.

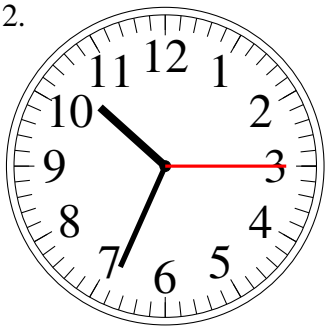

10:34.15

3.

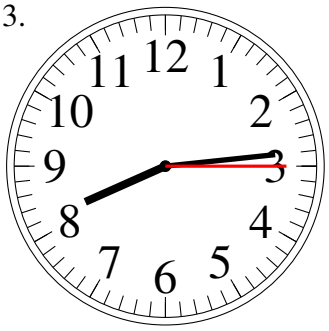

8:14.15

4.

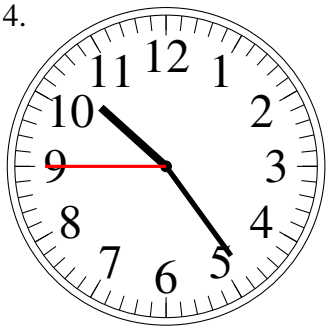

10:24.45

5.

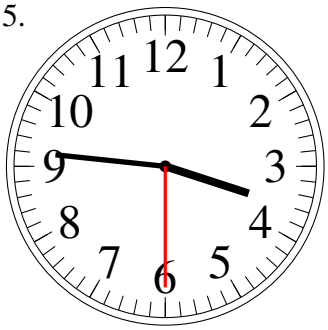

3:46.30

6.

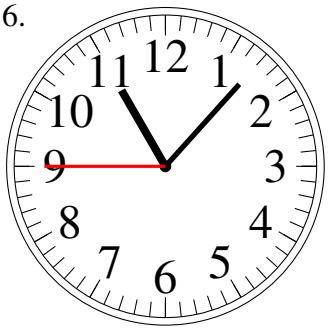

11:07.45

7.



1:24.00

8.

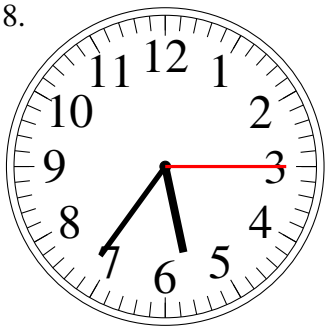

5:36.15

9.



11:23.30

10.



9:02.00

11.



12:52.00

12.

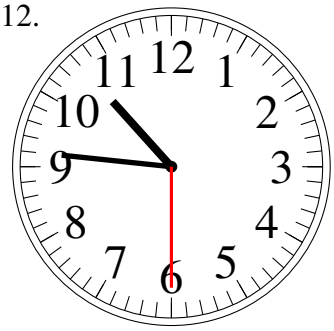

10:46.30

Lecture d'Horloge Analogue (B)

Lisez le temps indiqué et inscrivez le sous l'horloge.

1.
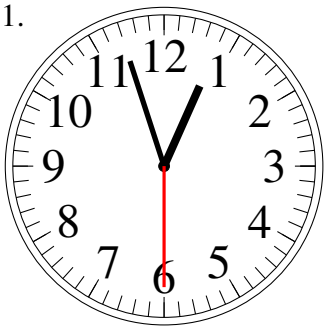

2.


3.
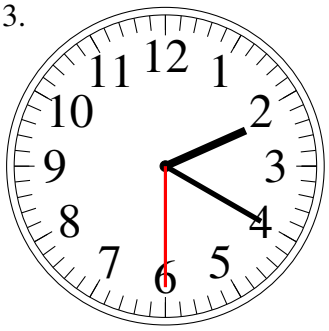

4.
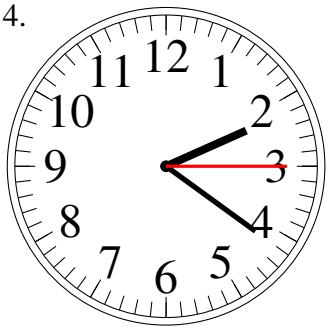

5.


6.


7.
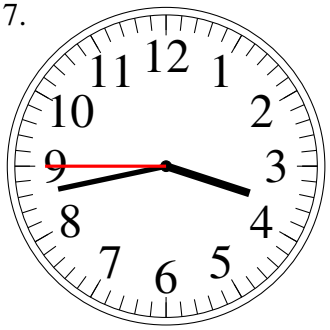

8.


9.


10.


11.
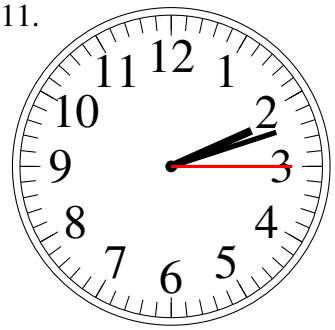

12.
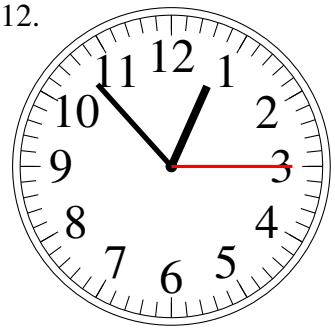

Lecture d'Horloge Analogue (B) Solutions

Lisez le temps indiqué et inscrivez le sous l'horloge.

1.

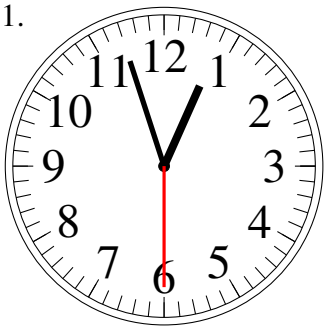

12:57.30

2.



8:38.45

3.

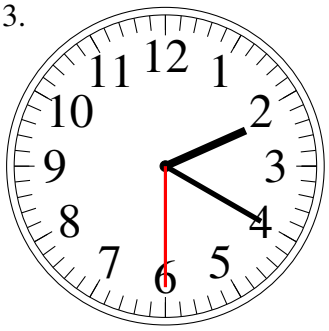

2:20.30

4.

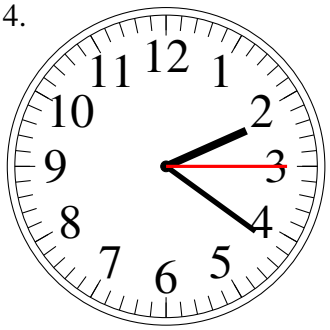

2:21.15

5.



5:20.30

6.



3:01.15

7.

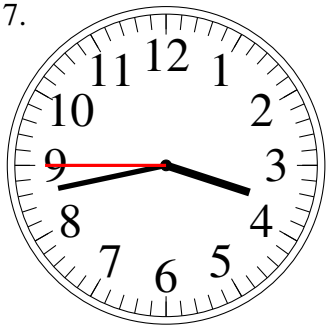

3:43.45

8.



2:54.15

9.



1:25.15

10.



3:56.15

11.



2:12.15

12.

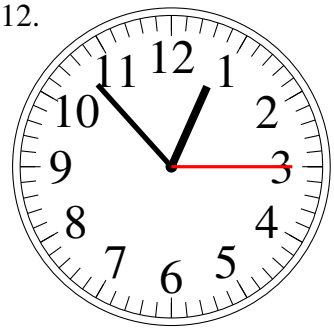

12:53.15

Lecture d'Horloge Analogue (C)

Lisez le temps indiqué et inscrivez le sous l'horloge.

1.
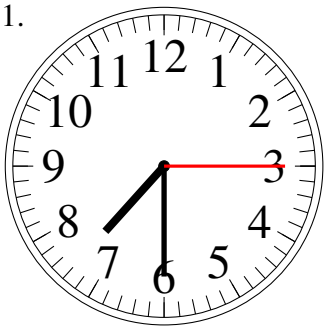

_____

2.


_____

3.
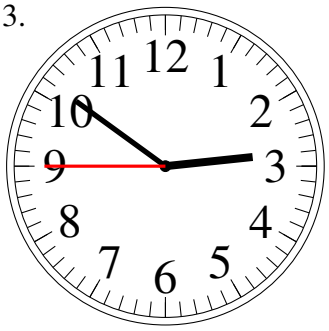

_____

4.


_____

5.
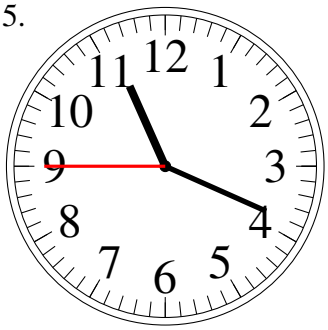

_____

6.


_____

7.


_____

8.


_____

9.


_____

10.
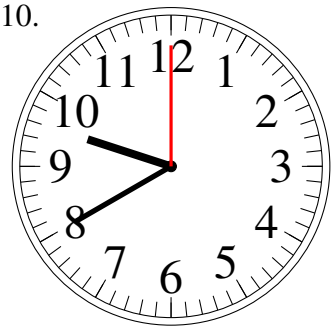

_____

11.
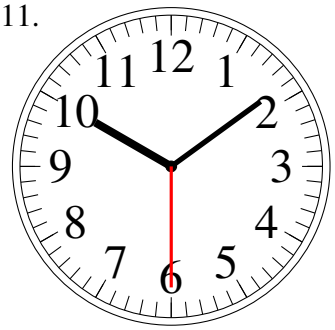

_____

12.
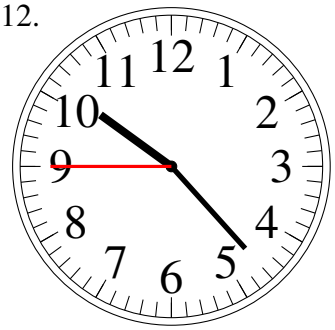

_____

Lecture d'Horloge Analogue (C) Solutions

Lisez le temps indiqué et inscrivez le sous l'horloge.

1.
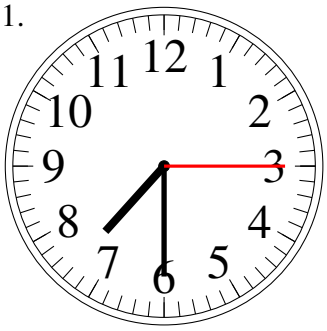

7:30.15

2.


9:52.00

3.
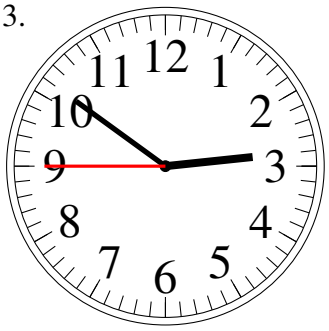

2:51.45

4.


7:10.00

5.
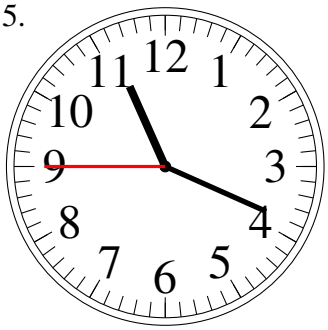

11:19.45

6.


10:15.15

7.


6:21.00

8.


7:48.00

9.


11:21.00

10.
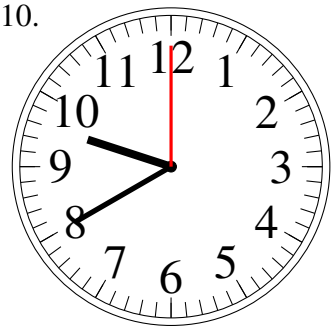

9:40.00

11.
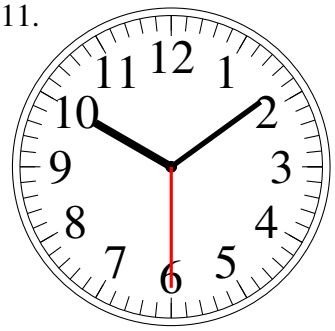

10:09.30

12.
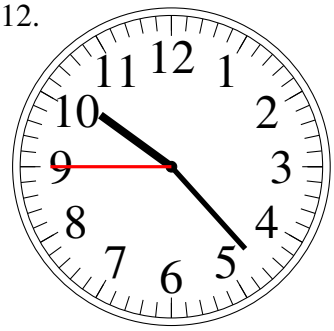

10:23.45

Lecture d'Horloge Analogue (D)

Lisez le temps indiqué et inscrivez le sous l'horloge.

1.
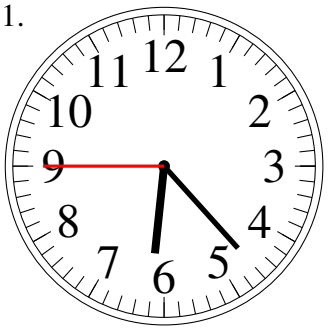

2.
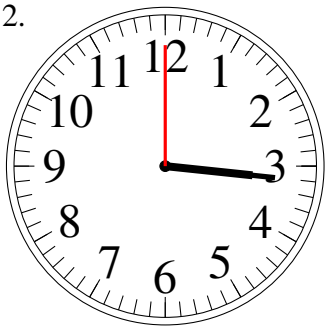

3.
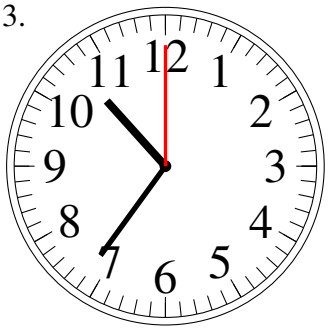

4.


5.
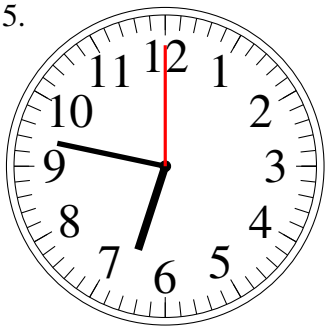

6.
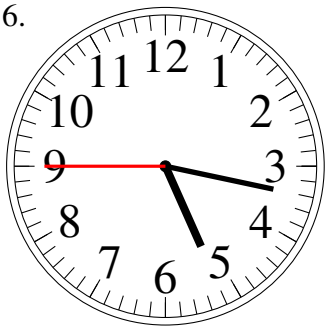

7.
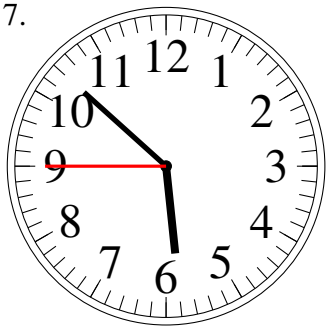

8.


9.
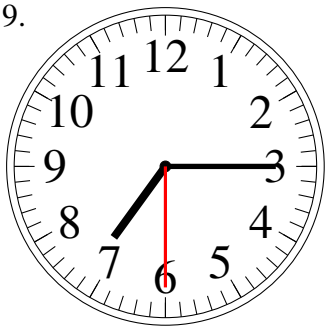

10.
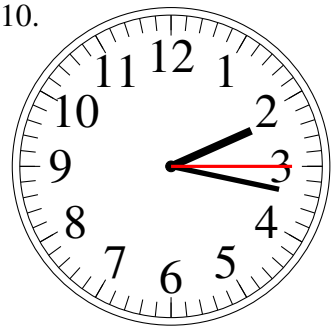

11.
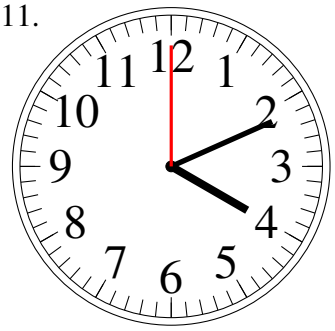

12.
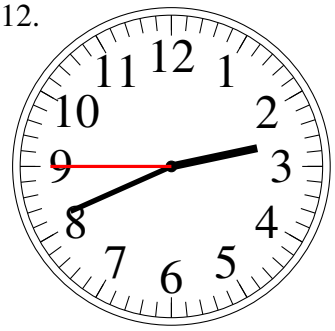

Lecture d'Horloge Analogue (D) Solutions

Lisez le temps indiqué et inscrivez le sous l'horloge.

1.
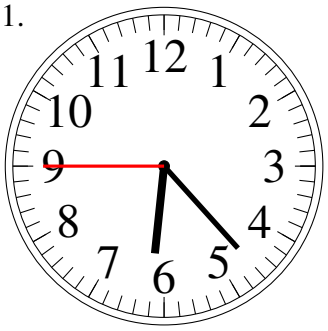
6:23.45

2.
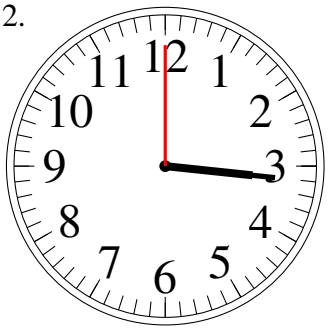
3:16.00

3.
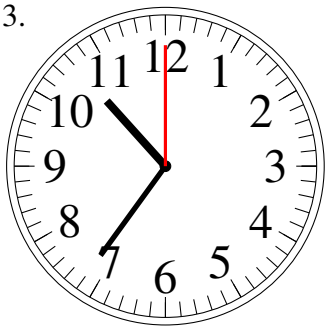
10:36.00

4.

7:40.15

5.
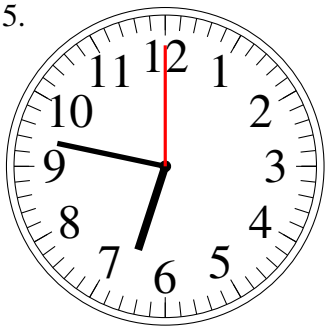
6:47.00

6.
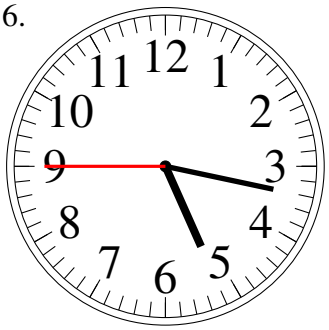
5:17.45

7.
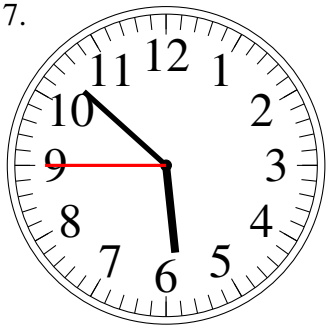
5:52.45

8.

10:20.15

9.

7:15.30

10.

2:17.15

11.
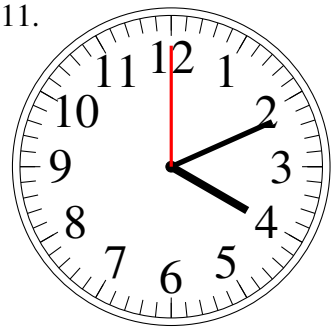
4:11.00

12.
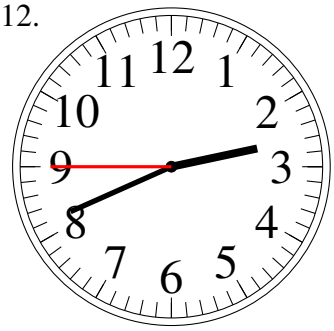
2:41.45

Lecture d'Horloge Analogue (E)

Lisez le temps indiqué et inscrivez le sous l'horloge.

1.


_____

2.


_____

3.
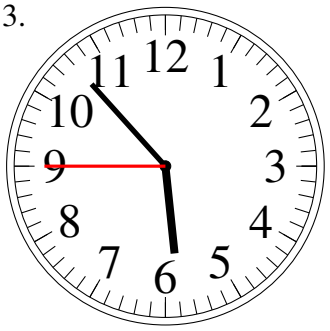

_____

4.
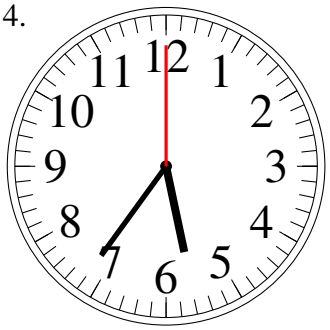

_____

5.
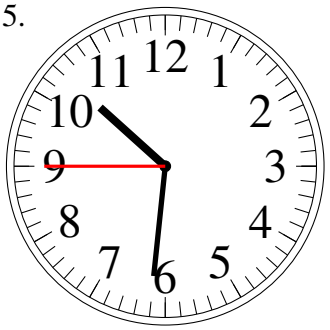

_____

6.
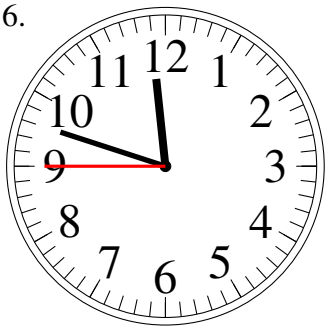

_____

7.
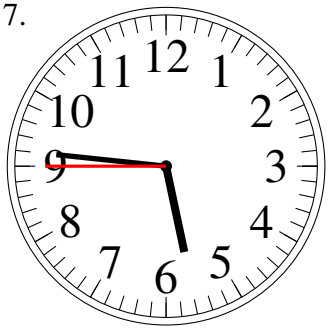

_____

8.


_____

9.
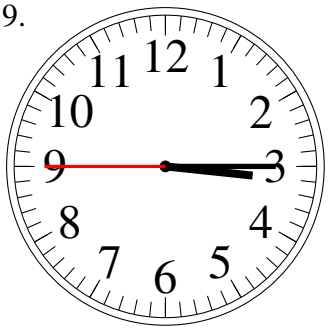

_____

10.


_____

11.
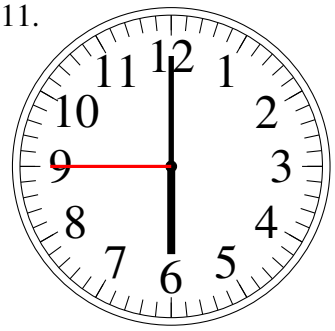

_____

12.


_____

Lecture d'Horloge Analogue (E) Solutions

Lisez le temps indiqué et inscrivez le sous l'horloge.

1.



11:26.30

2.



9:56.00

3.

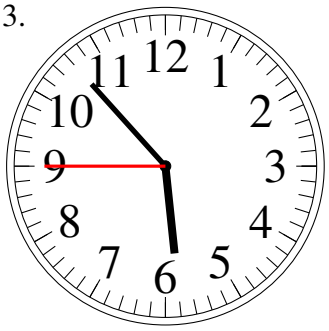

5:53.45

4.

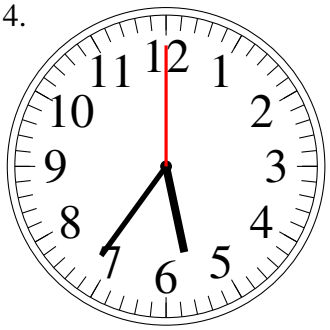

5:36.00

5.

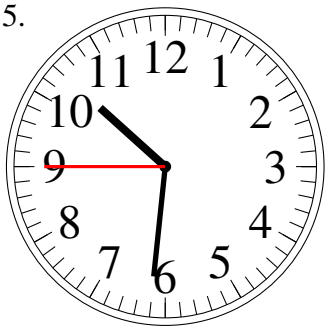

10:31.45

6.

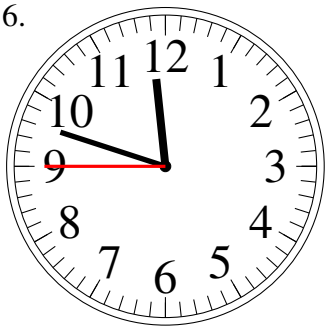

11:48.45

7.

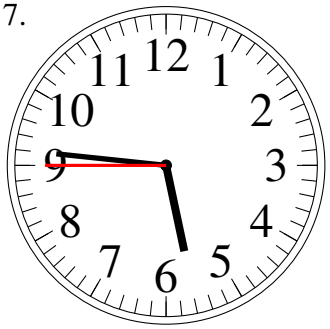

5:46.45

8.



6:17.00

9.

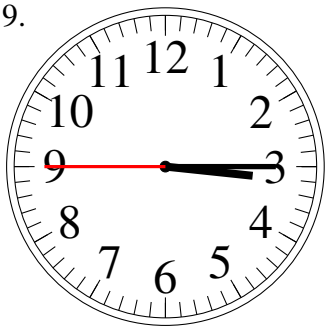

3:15.45

10.



10:23.00

11.

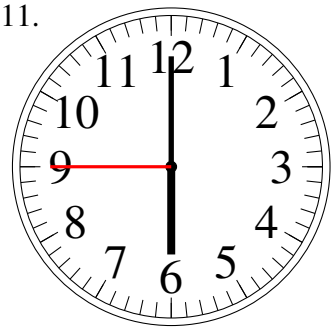

6:00.45

12.



4:05.30

Lecture d'Horloge Analogue (F)

Lisez le temps indiqué et inscrivez le sous l'horloge.

1.


_____

2.


_____

3.
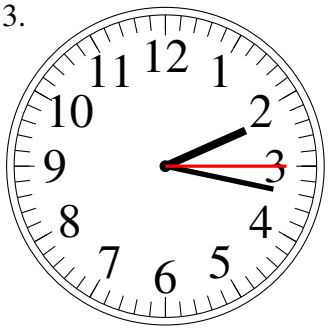

_____

4.
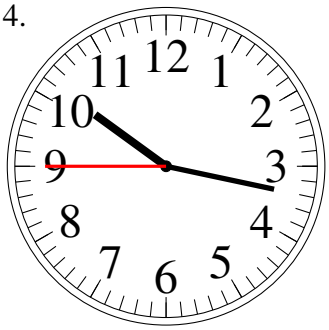

_____

5.


_____

6.


_____

7.


_____

8.


_____

9.
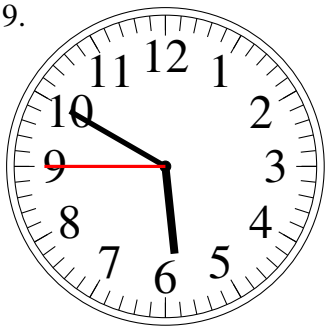

_____

10.


_____

11.
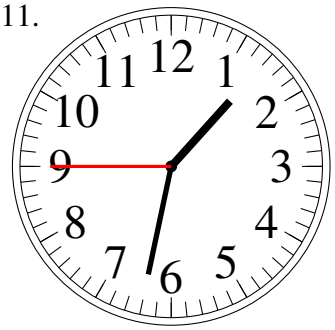

_____

12.
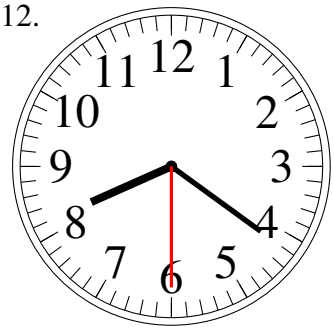

_____

Lecture d'Horloge Analogue (F) Solutions

Lisez le temps indiqué et inscrivez le sous l'horloge.

1.



12:21.15

2.



4:58.30

3.

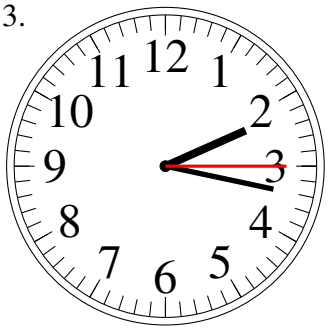

2:17.15

4.

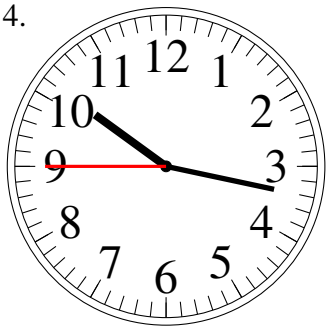

10:17.45

5.



2:55.15

6.

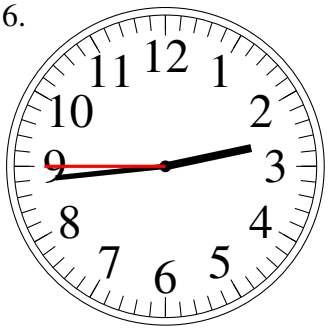

2:44.45

7.



10:17.00

8.



3:31.00

9.

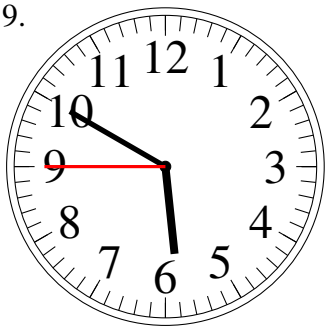

5:50.45

10.



2:26.30

11.

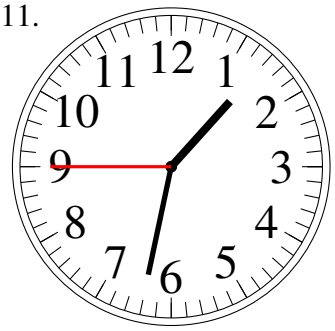

1:32.45

12.

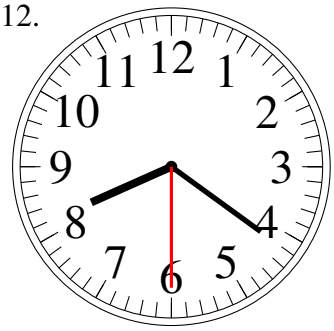

8:21.30

Lecture d'Horloge Analogue (G)

Lisez le temps indiqué et inscrivez le sous l'horloge.

1.
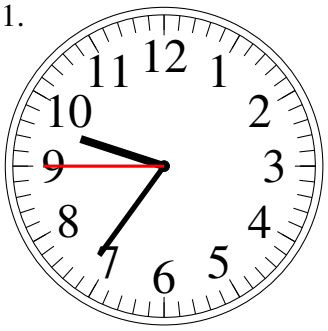

2.
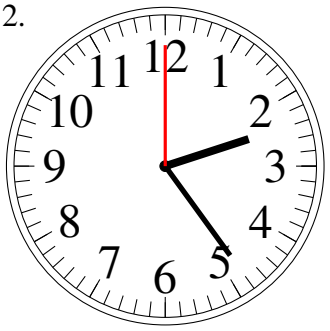

3.
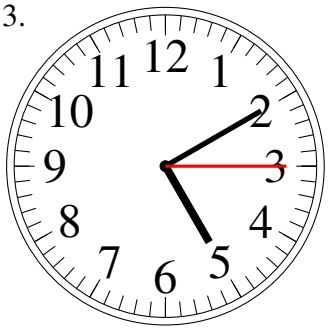

4.


5.
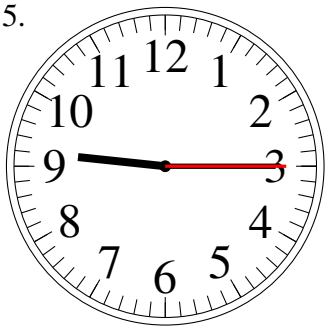

6.


7.
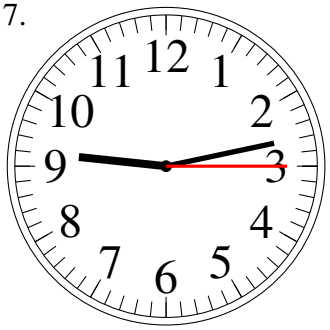

8.
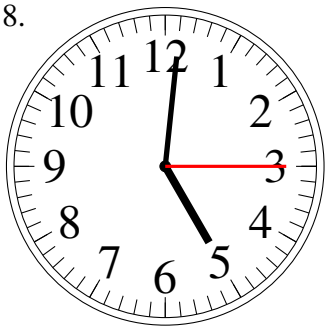

9.


10.
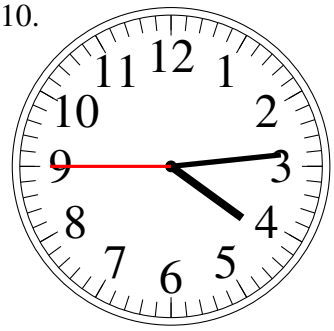

11.
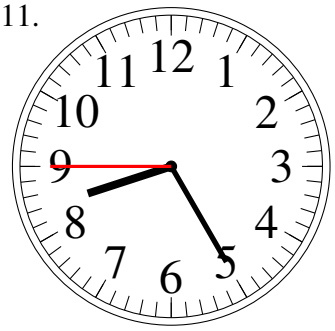

12.
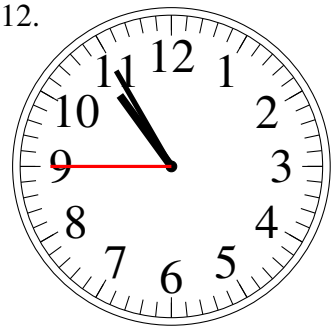

Lecture d'Horloge Analogue (G) Solutions

Lisez le temps indiqué et inscrivez le sous l'horloge.

1.

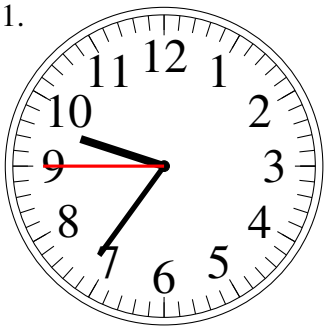

9:36.45

2.

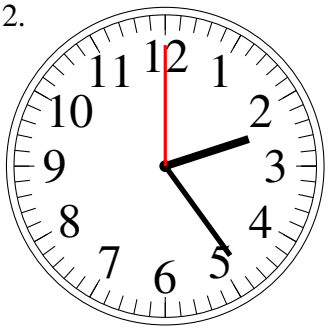

2:24.00

3.

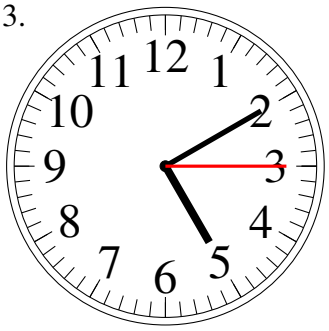

5:10.15

4.



10:08.15

5.

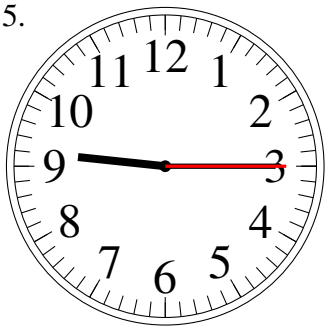

9:15.15

6.



12:08.30

7.

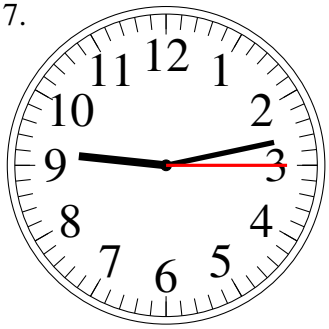

9:13.15

8.



5:01.15

9.



5:52.00

10.

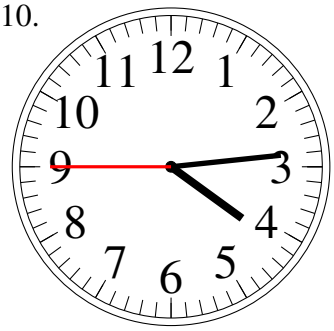

4:14.45

11.

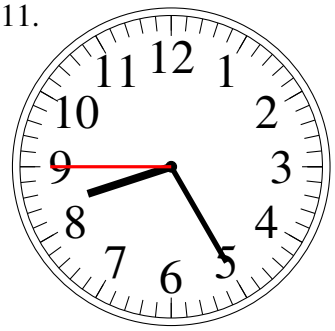

8:25.45

12.

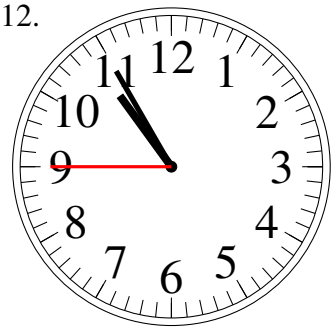

10:55.45

Lecture d'Horloge Analogue (H)

Lisez le temps indiqué et inscrivez le sous l'horloge.

1.
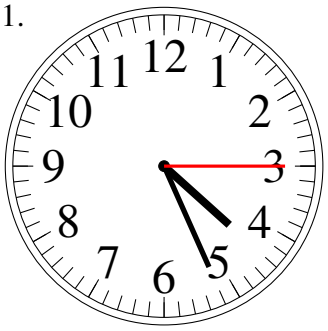

2.


3.
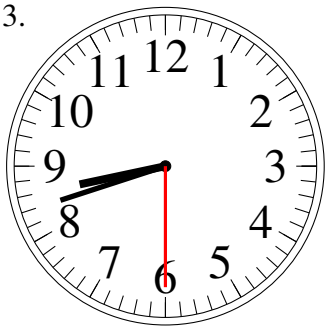

4.


5.
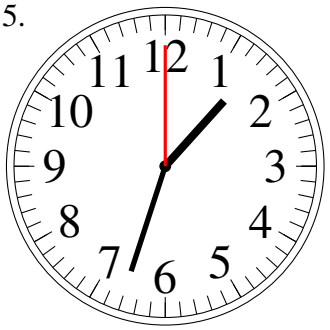

6.


7.
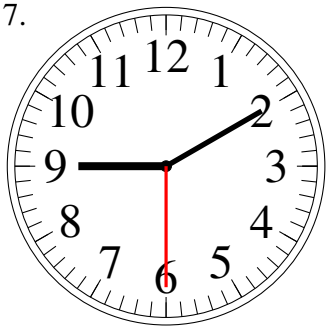

8.


9.
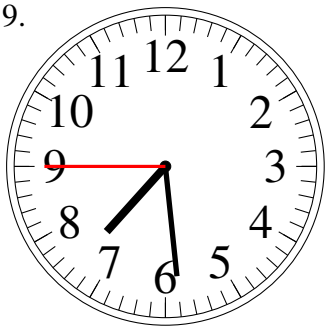

10.
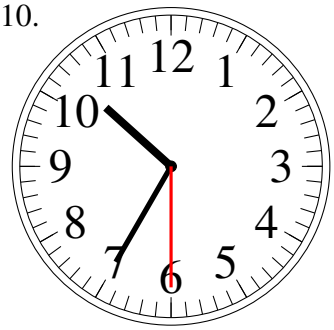

11.


12.
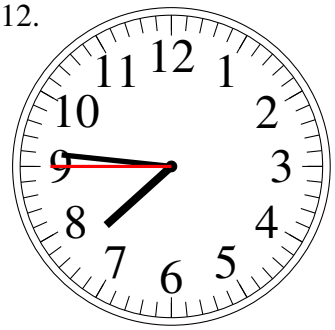

Lecture d'Horloge Analogue (H) Solutions

Lisez le temps indiqué et inscrivez le sous l'horloge.

1.
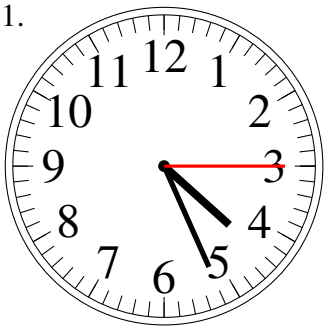
4:26.15

2.

5:25.00

3.
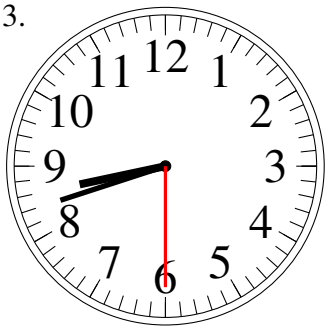
8:42.30

4.

7:55.00

5.

1:33.00

6.

6:22.30

7.
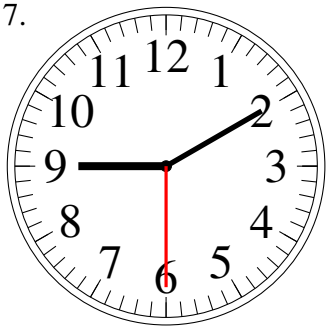
9:10.30

8.

10:13.00

9.
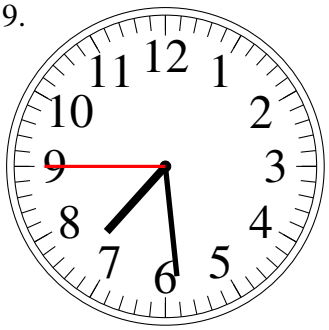
7:29.45

10.

10:35.30

11.

2:10.30

12.

7:46.45

Lecture d'Horloge Analogue (I)

Lisez le temps indiqué et inscrivez le sous l'horloge.

1.


2.


3.
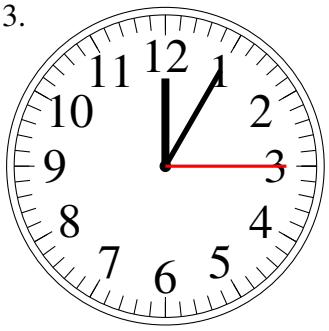

4.


5.
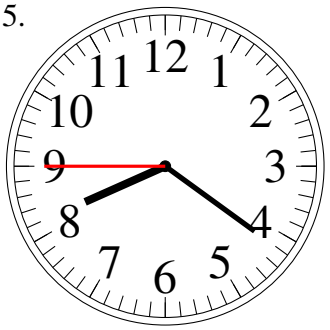

6.


7.
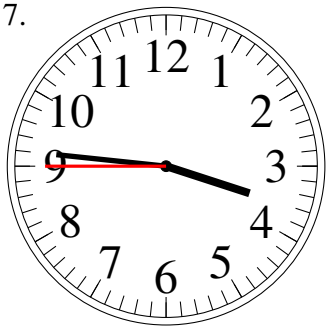

8.


9.


10.


11.


12.


Lecture d'Horloge Analogue (I) Solutions

Lisez le temps indiqué et inscrivez le sous l'horloge.

1.



1:44.45

2.



6:52.30

3.

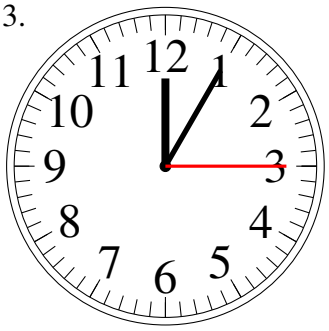

12:05.15

4.



9:06.15

5.

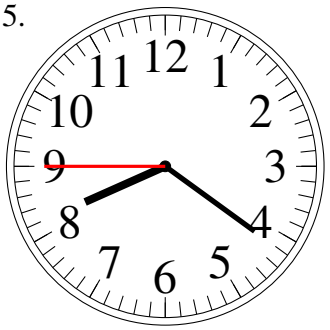

8:21.45

6.



2:09.45

7.



3:46.45

8.



2:46.45

9.



3:19.00

10.



2:31.00

11.



11:06.00

12.



9:08.45

Lecture d'Horloge Analogue (J)

Lisez le temps indiqué et inscrivez le sous l'horloge.

1.
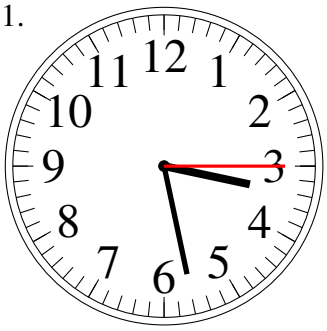

2.
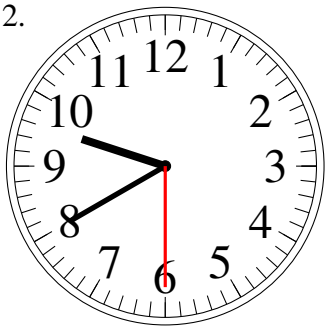

3.
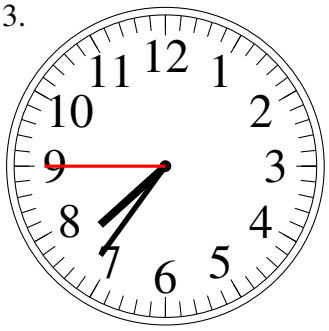

4.


5.
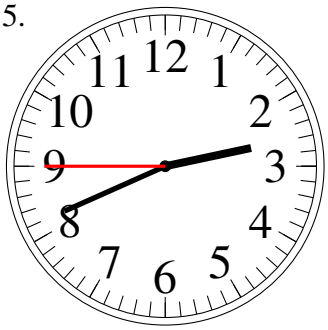

6.
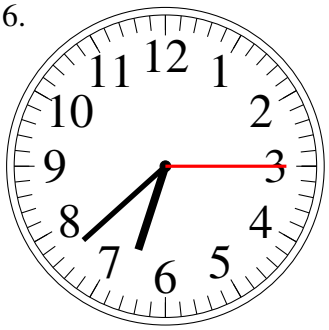

7.
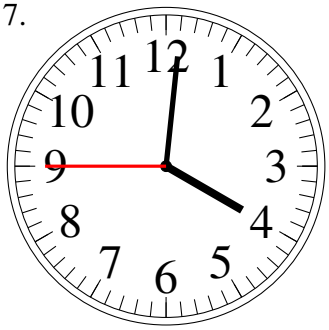

8.


9.


10.


11.
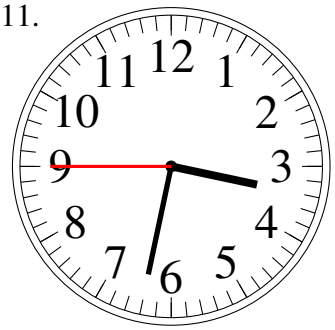

12.
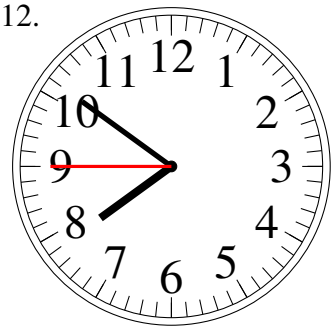

Lecture d'Horloge Analogue (J) Solutions

Lisez le temps indiqué et inscrivez le sous l'horloge.

1.

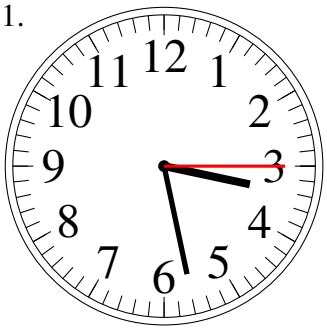

3:28.15

2.

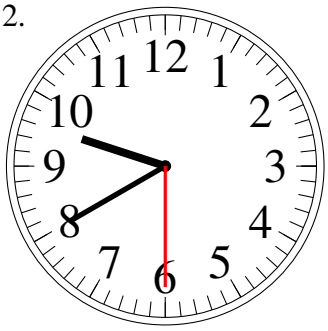

9:40.30

3.

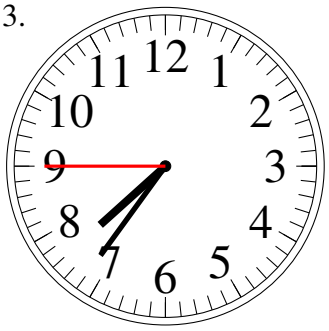

7:36.45

4.



8:10.30

5.

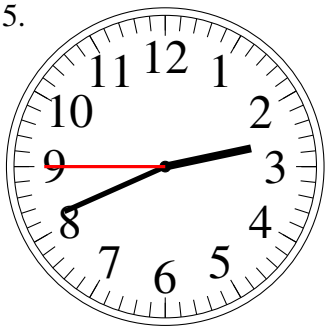

2:41.45

6.

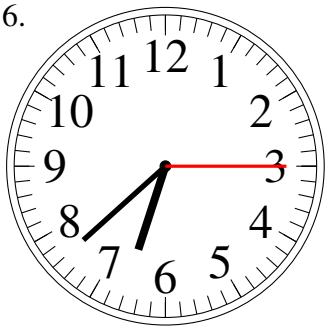

6:38.15

7.

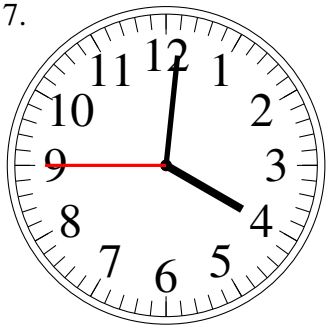

4:01.45

8.



11:03.15

9.



9:11.00

10.



1:01.00

11.

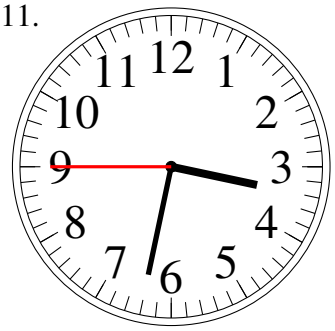

3:32.45

12.

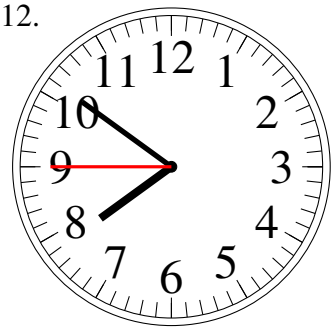

7:51.45