Lecture d'Horloge Analogue (E)

Lisez le temps indiqué et inscrivez le sous l'horloge.

1.
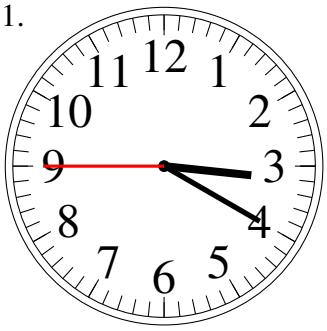

2.
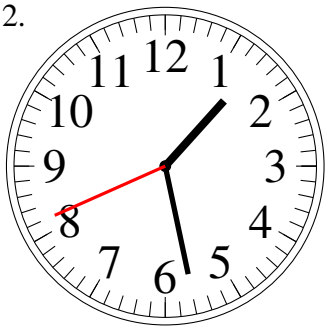

3.
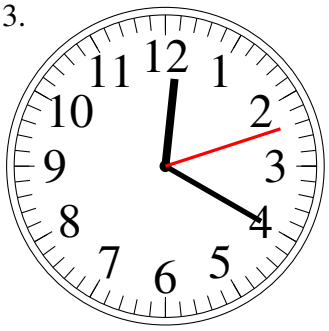

4.


5.


6.
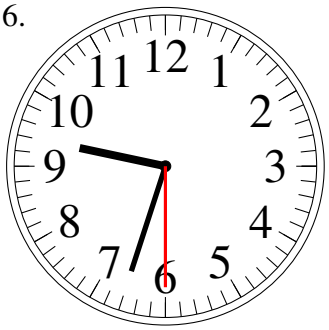

7.


8.


9.
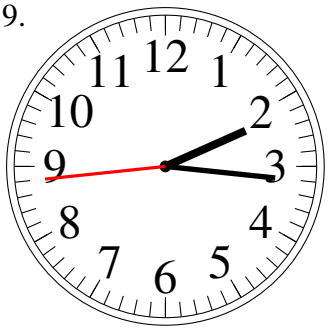

10.


11.


12.


Lecture d'Horloge Analogue (E) Solutions

Lisez le temps indiqué et inscrivez le sous l'horloge.

1.

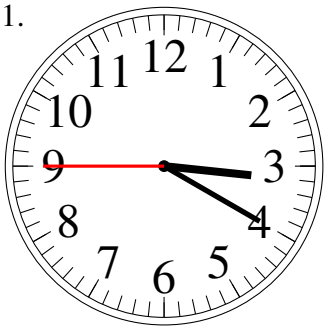

3:20.45

2.

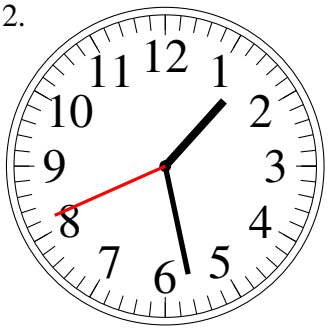

1:28.41

3.

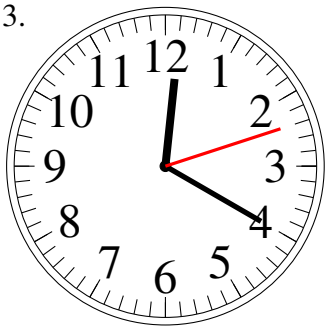

12:20.12

4.



12:09.39

5.



4:57.01

6.

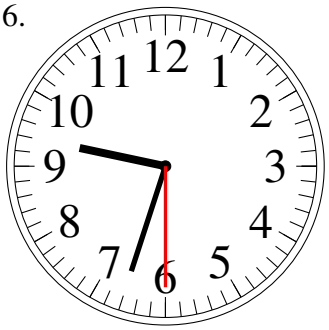

9:33.30

7.



7:27.06

8.



1:04.08

9.

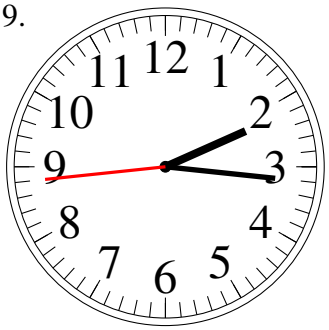

2:16.44

10.



10:47.51

11.



11:55.13

12.



1:19.27