Lecture d'Horloge Analogue (C)

Lisez le temps indiqué et inscrivez le sous l'horloge.

1.
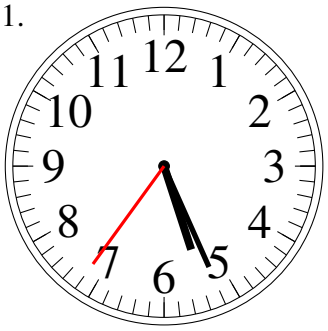

_____

2.
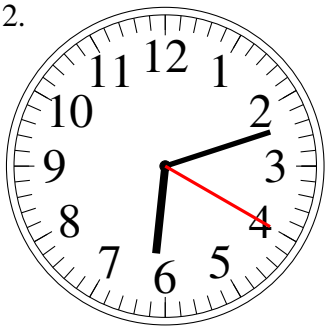

_____

3.
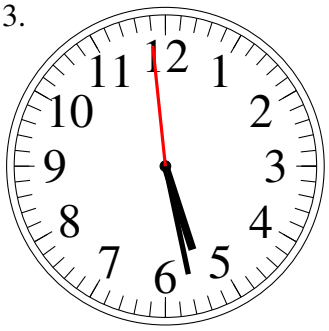

_____

4.
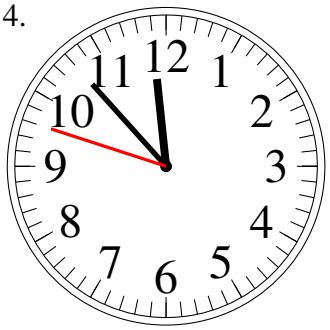

_____

5.


_____

6.
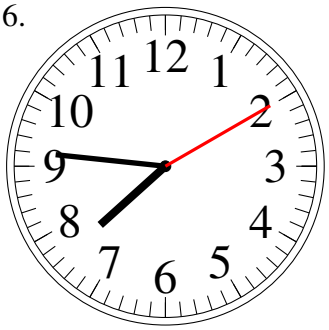

_____

7.
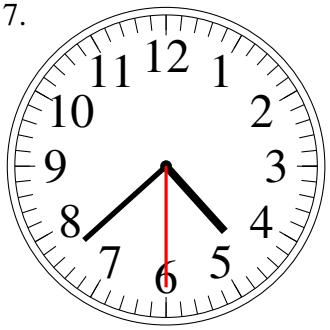

_____

8.


_____

9.
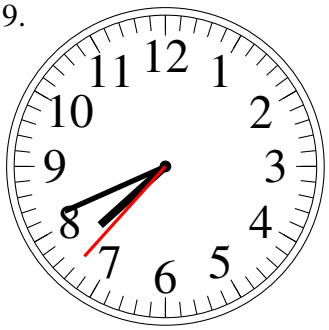

_____

10.
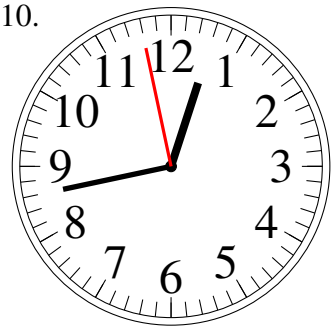

_____

11.


_____

12.
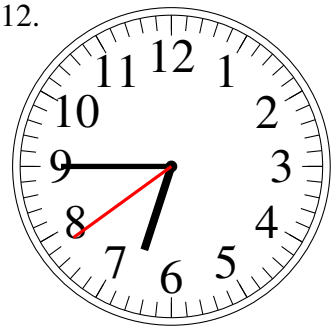

_____

Lecture d'Horloge Analogue (C) Solutions

Lisez le temps indiqué et inscrivez le sous l'horloge.

1.
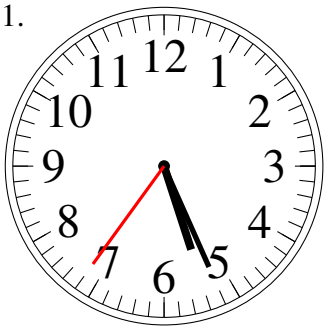
5:26.36

2.
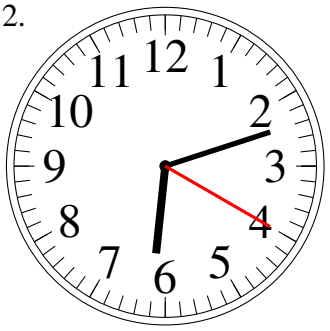
6:12.20

3.
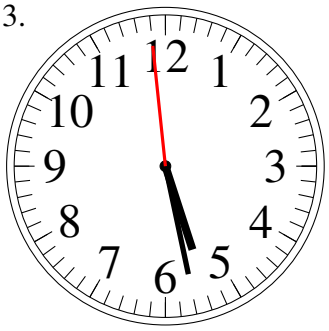
5:28.59

4.
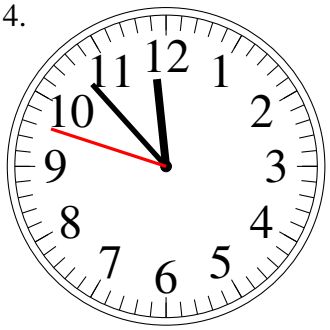
11:53.48

5.

7:37.00

6.

7:46.10

7.
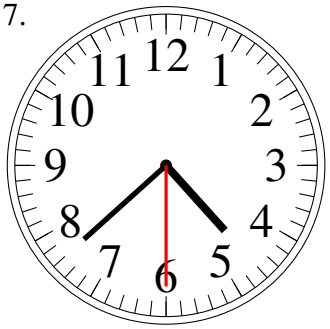
4:38.30

8.

9:29.31

9.
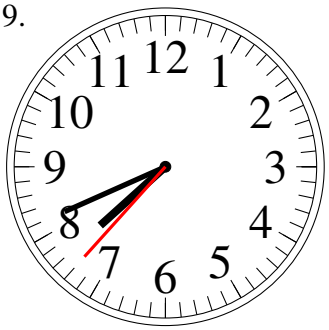
7:41.37

10.
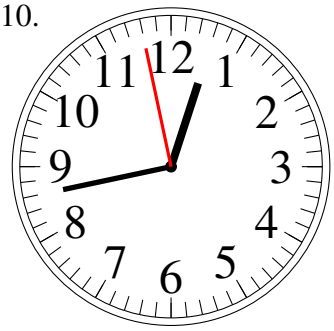
12:43.58

11.

3:52.53

12.
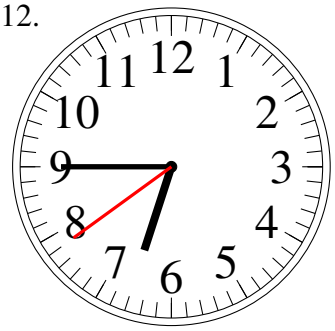
6:45.39