Aire et Périmètre de Parallélogrammes (J)

Trouvez l'aire et le périmètre de chaque parallélogramme.

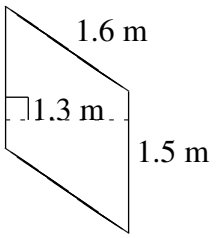

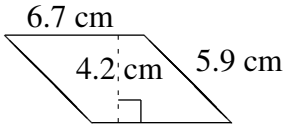

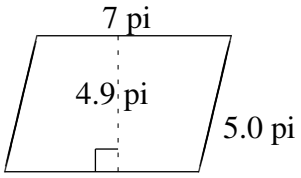

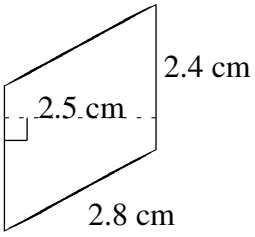

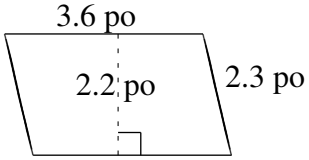

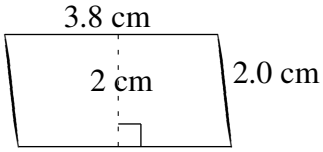

Aire et Périmètre de Parallélogrammes (J) Solutions

Trouvez l'aire et le périmètre de chaque parallélogramme.

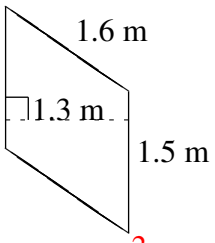

A = 1.95 m^2
P = 6.2 m

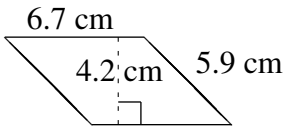

A = 28.14 cm^2
P = 25.2 cm

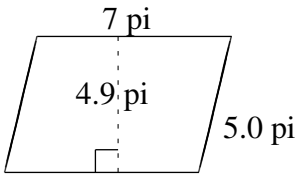

A = 34.3 pi^2
P = 24.0 pi

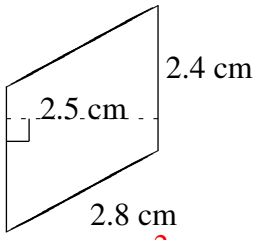

A = 6.00 cm^2
P = 10.4 cm

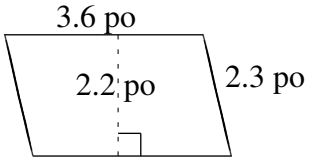

A = 7.92 po^2
P = 11.8 po

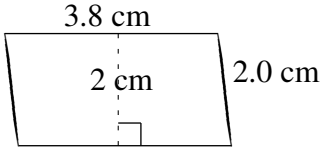

A = 7.6 cm^2
P = 11.6 cm