Aire et Périmètre de Parallélogrammes (A)

Trouvez l'aire et le périmètre de chaque parallélogramme.

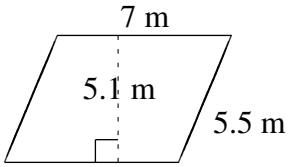

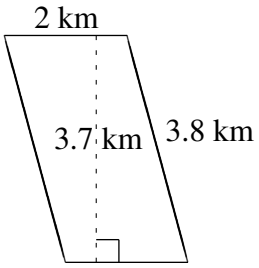

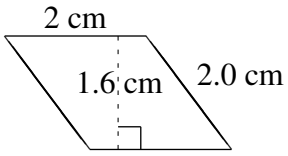

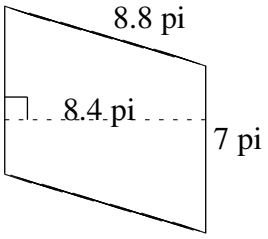

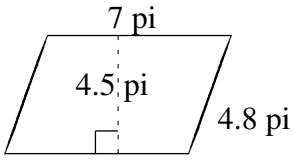

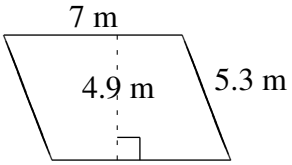

Aire et Périmètre de Parallélogrammes (A) Solutions

Trouvez l'aire et le périmètre de chaque parallélogramme.

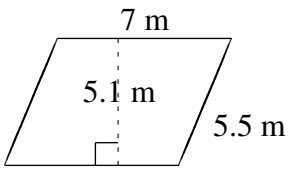

A = 35.7 m^2
P = 25.0 m

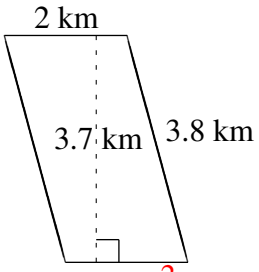

A = 7.4 km^2
P = 11.6 km

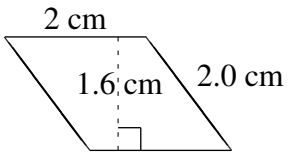

A = 3.2 cm^2
P = 8.0 cm

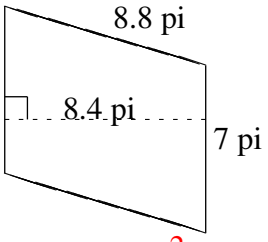

A = 58.8 pi^2
P = 31.6 pi

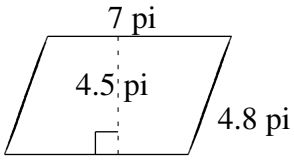

A = 31.5 pi^2
P = 23.6 pi

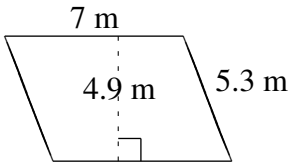

A = 34.3 m^2
P = 24.6 m