Aire et Périmètre d'un Triangle (G)

Calculez l'aire et le périmètre des triangles à l'aide de la formule de Héron.

1.

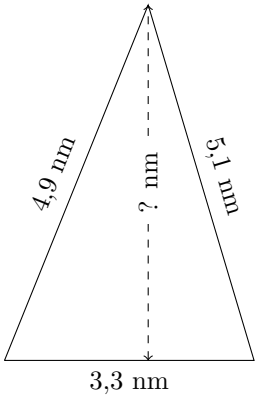

P = ? nm
A = ? nm^2

2.

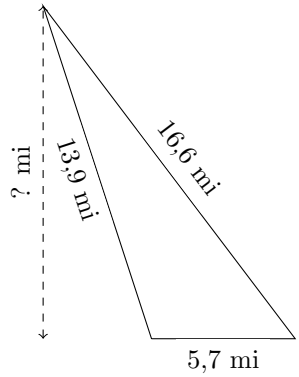

P = ? mi
A = ? mi^2

3.

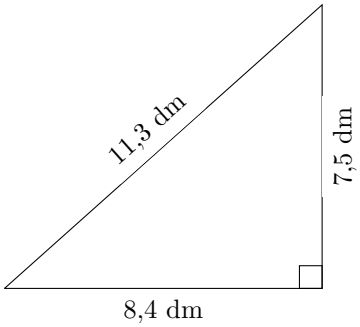

P = ? dm
A = ? dm^2

4.

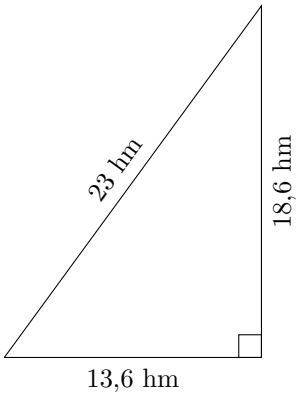

P = ? hm
A = ? hm^2

5.

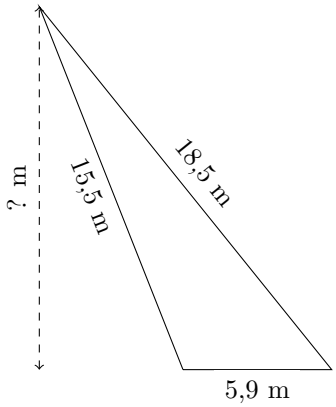

P = ? m
A = ? m^2

6.

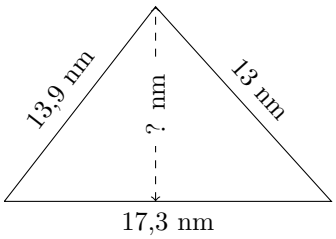

P = ? nm
A = ? nm^2

Aire et Périmètre d'un Triangle (G) Réponses

Calculez l'aire et le périmètre des triangles à l'aide de la formule de Héron.

1.

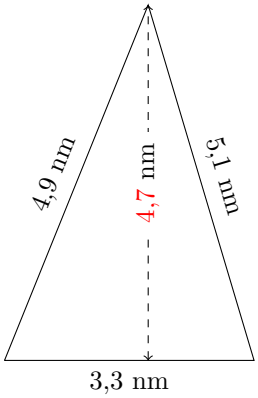

P = 13,3 nm
A = 7,774 nm^2

2.

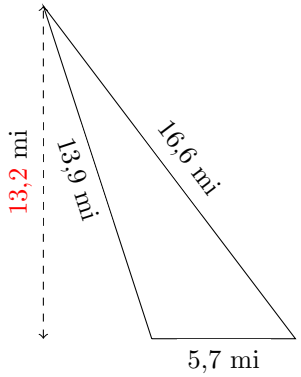

P = 36,2 mi
A = 37,603 mi^2

3.

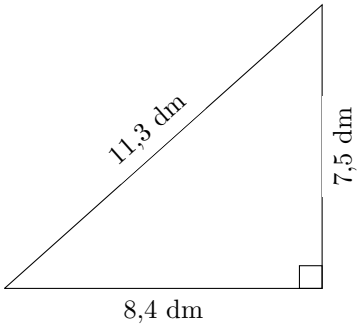

P = 27,2 dm
A = 31,499 dm^2

4.

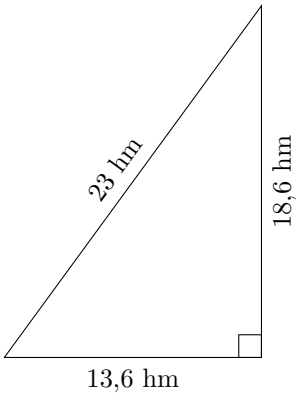

P = 55,2 hm
A = 126,479 hm^2

5.

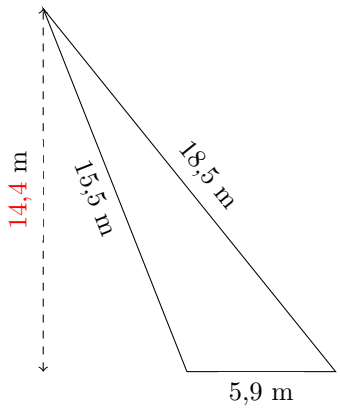

P = 39,9 m
A = 42,528 m^2

6.

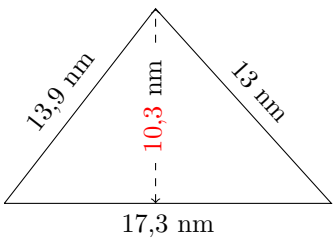

P = 44,2 nm
A = 88,97 nm^2