Perimètre et Aire d'un Triangle (D)

Calculez le perimètre et l'aire de chaque triangle.

1.

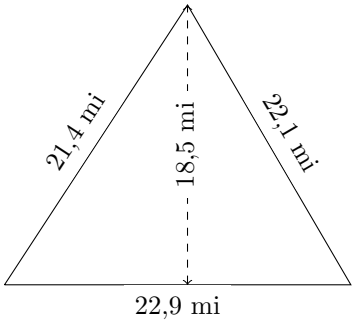

P = ? mi
A = ? mi^2

2.

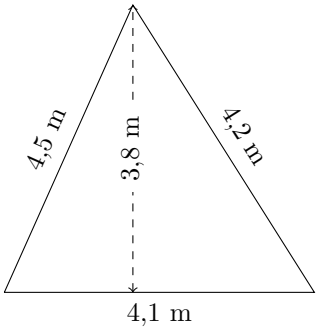

P = ? m
A = ? m^2

3.

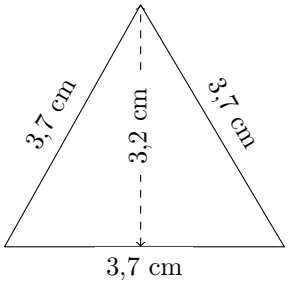

P = ? cm
A = ? cm^2

4.

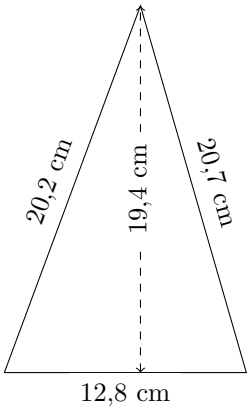

P = ? cm
A = ? cm^2

5.

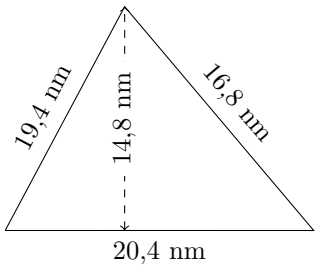

P = ? nm
A = ? nm^2

6.

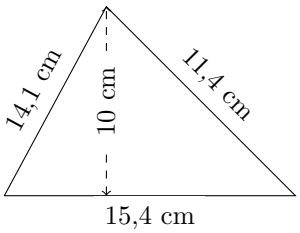

P = ? cm
A = ? cm^2

Perimètre et Aire d'un Triangle (D) Réponses

Calculez le perimètre et l'aire de chaque triangle.

1.

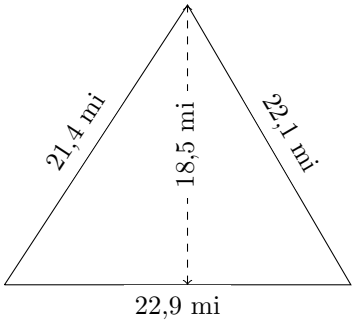

P = 66,4 mi
A = 211,825 mi^2

2.

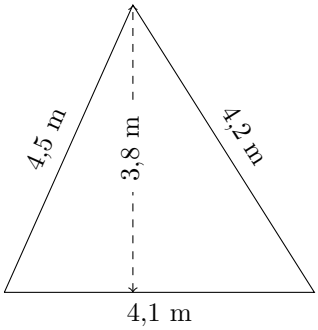

P = 12,8 m
A = 7,79 m^2

3.

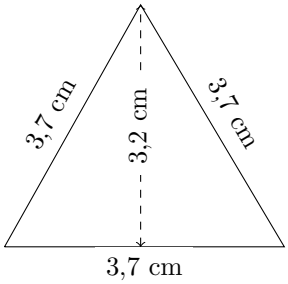

P = 11,1 cm
A = 5,92 cm^2

4.

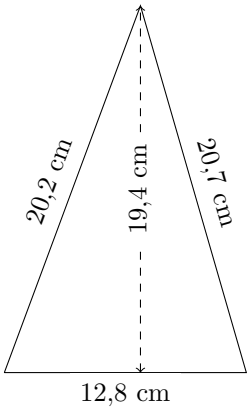

P = 53,7 cm
A = 124,16 cm^2

5.

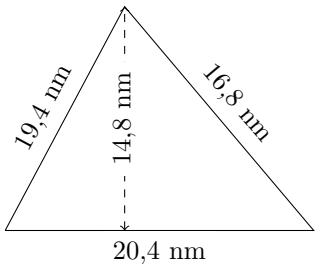

P = 56,6 nm
A = 150,96 nm^2

6.

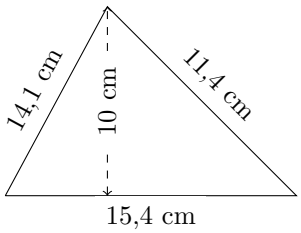

P = 40,9 cm
A = 77 cm^2