Mesure d'un Rectangle (I)

Calculez les mesures manquantes pour chaque rectangle.

1.

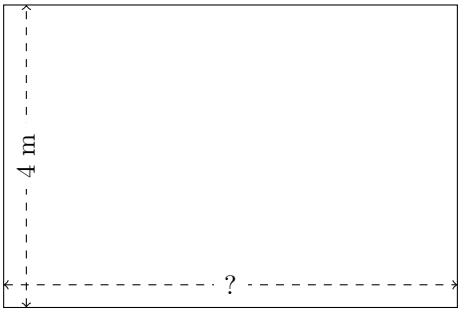

P = 20 m
A = ?

2.

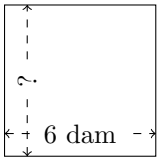

P = 24 dam
A = ?

3.

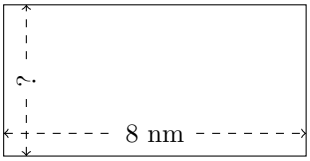

P = 24 nm
A = ?

4.

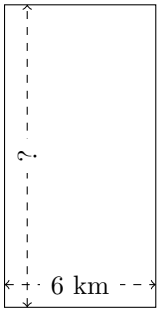

P = 36 km
A = ?

5.



P = 28 hm
A = ?

6.

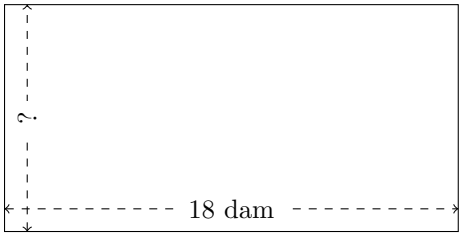

P = 54 dam
A = ?

Mesure d'un Rectangle (I) Réponses

Calculez les mesures manquantes pour chaque rectangle.

1.

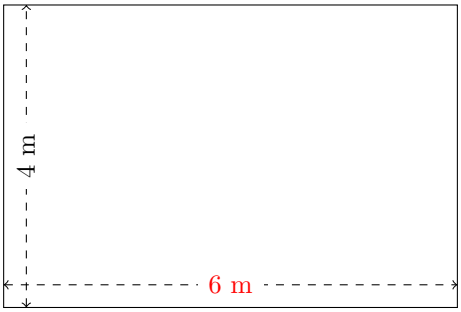

P = 20 m

A = 24 m^2

2.

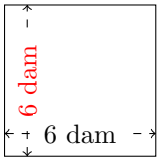

P = 24 dam

A = 36 dam^2

3.

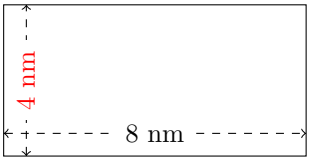

P = 24 nm

A = 32 nm^2

4.

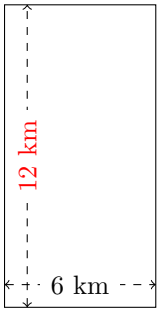

P = 36 km

A = 72 km^2

5.

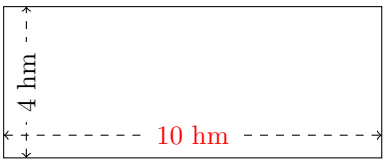

P = 28 hm

A = 40 hm^2

6.

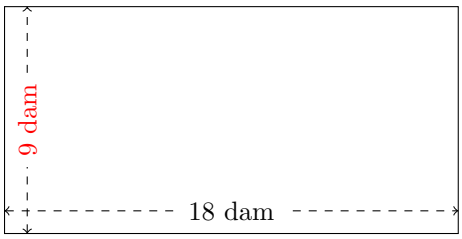

P = 54 dam

A = 162 dam^2