Aire et Hauteur d'un Triangle Rectangle (D)

Calculez l'aire et la hauteur de chaque triangle rectangle.

1.

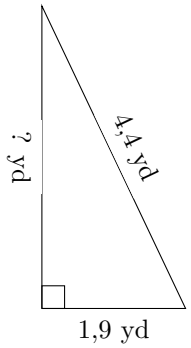

P = 10,3 yd
A = ? yd^2

2.

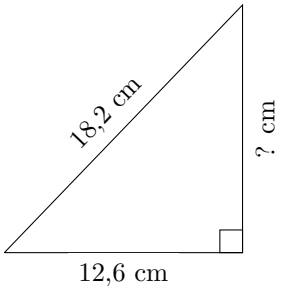

P = 43,9 cm
A = ? cm^2

3.

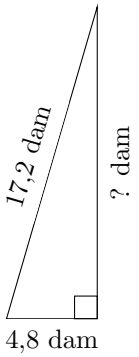

P = 38,5 dam
A = ? dam^2

4.

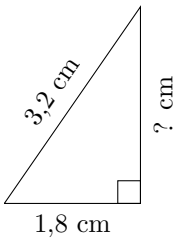

P = 7,6 cm
A = ? cm^2

5.

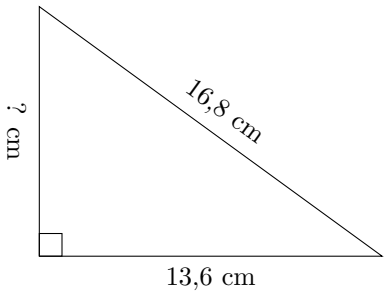

P = 40,3 cm
A = ? cm^2

6.

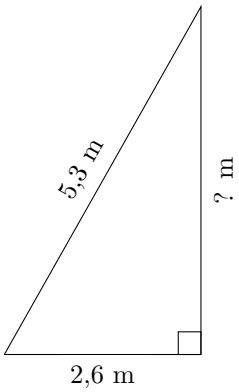

P = 12,5 m
A = ? m^2

Aire et Hauteur d'un Triangle Rectangle (D) Réponses

Calculez l'aire et la hauteur de chaque triangle rectangle.

1.

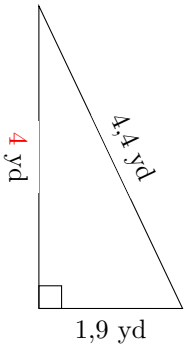

P = 10,3 yd
A = 3,8 yd^2

2.

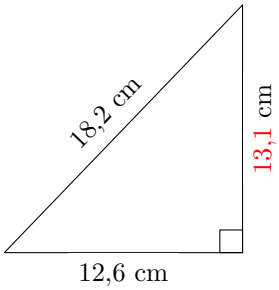

P = 43,9 cm
A = 82,53 cm^2

3.

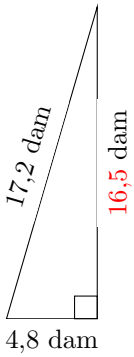

P = 38,5 dam
A = 39,6 dam^2

4.

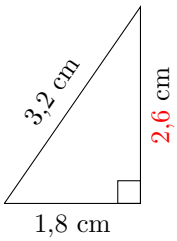

P = 7,6 cm
A = 2,34 cm^2

5.

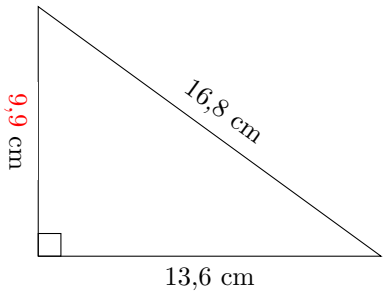

P = 40,3 cm
A = 67,32 cm^2

6.

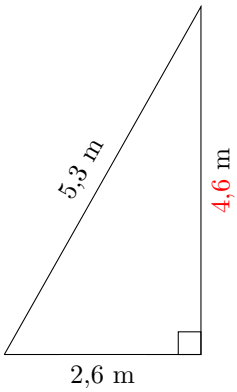

P = 12,5 m
A = 5,98 m^2