Chiffres Fondus Division (B)

Nom: _____ Date: _____

Retrouve les chiffres qui ont fondu à la chaleur du soleil.

1. $\begin{array}{r} 10 \\ \square\,\overline{)\,80} \end{array}$

2. $\begin{array}{r} \square \\ 4\,\overline{)\,16} \end{array}$

3. $\begin{array}{r} \square \\ 9\,\overline{)\,63} \end{array}$

4. $\begin{array}{r} 11 \\ 4\,\overline{)\,4\square} \end{array}$









5. $\begin{array}{r} 1\square \\ 8\,\overline{)\,96} \end{array}$

6. $\begin{array}{r} 7 \\ 10\,\overline{)\,7\square} \end{array}$

7. $\begin{array}{r} 8 \\ \square\,\overline{)\,56} \end{array}$

8. $\begin{array}{r} \square \\ 12\,\overline{)\,96} \end{array}$









9. $\begin{array}{r} \square \\ 11\,\overline{)\,99} \end{array}$

10. $\begin{array}{r} 11 \\ 12\,\overline{)\,\square 3\square} \end{array}$

11. $\begin{array}{r} 11 \\ 11\,\overline{)\,\square 2\square} \end{array}$

12. $\begin{array}{r} 12 \\ 1\square\,\overline{)\,\square 20} \end{array}$









13. $\begin{array}{r} 1\square \\ 11\,\overline{)\,\square 32} \end{array}$

14. $\begin{array}{r} 8 \\ \square\,\overline{)\,16} \end{array}$

15. $\begin{array}{r} 4 \\ 1\square\,\overline{)\,48} \end{array}$

16. $\begin{array}{r} 11 \\ \square\,\overline{)\,44} \end{array}$









17. $\begin{array}{r} \square \\ 7\,\overline{)\,35} \end{array}$

18. $\begin{array}{r} 5 \\ 10\,\overline{)\,5\square} \end{array}$

19. $\begin{array}{r} 1\square \\ 10\,\overline{)\,\square 20} \end{array}$

20. $\begin{array}{r} 12 \\ \square\,\overline{)\,48} \end{array}$