Construction du Milieu d'un Segment (C)

Nom: _____ Date: _____
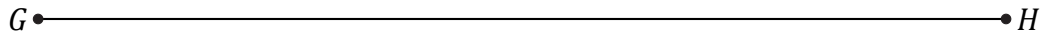
Construisez le milieu d'un segment à l'aide d'une règle et un compas.