Médiatrice d'un Segment (B)

Nom: _____ Date: _____
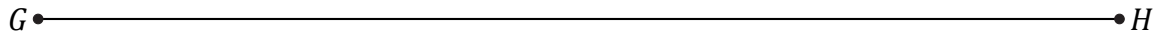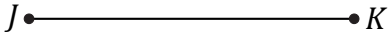
Construisez la médiatrice à l'aide d'une règle et un compas.