Classification de Triangles (C)

Classifiez chaque triangle à l'aide des mesures d'angles.

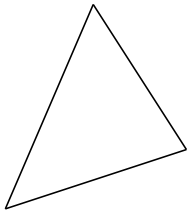

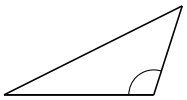

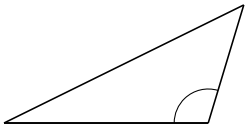

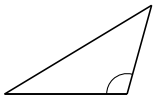

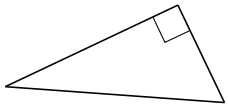

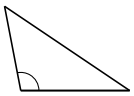

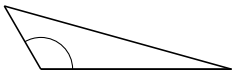

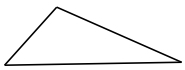

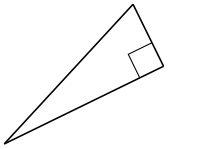

Classification de Triangles (C) Solutions

Classifiez chaque triangle à l'aide des mesures d'angles.

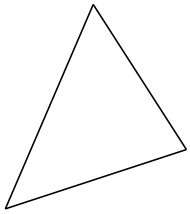

aigu

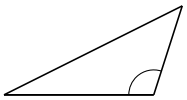

obtus

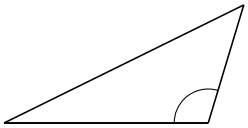

obtus

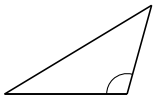

obtus

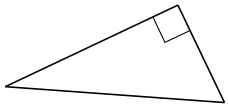

droit

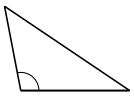

obtus

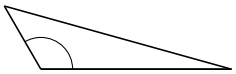

obtus

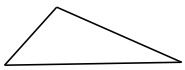

aigu

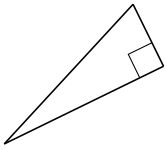

droit

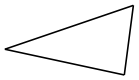

aigu