Calcul du Rayon et Diamètre des Cercles (F)

Calculez les mesures de chaque cercles à l'aide de la mesure donnée. Utlisez pi = 3.14

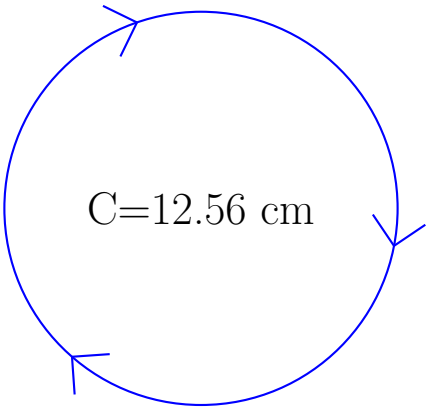

rayon = _____

diamètre = _____

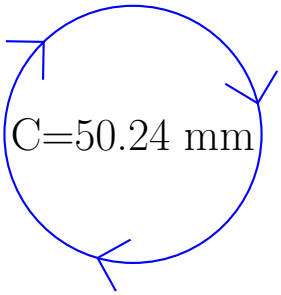

rayon = _____

diamètre = _____

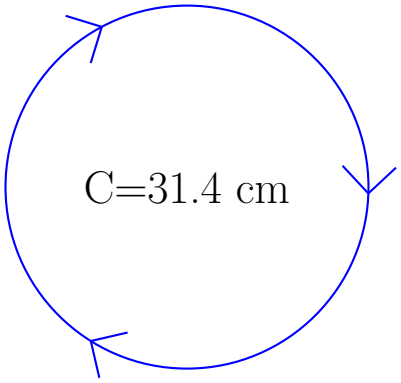

rayon = _____

diamètre = _____

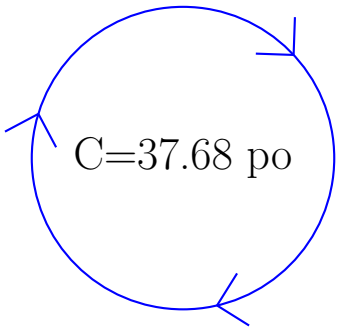

rayon = _____

diamètre = _____