Calcul du Rayon et Diamètre des Cercles (B)

Calculez les mesures de chaque cercles à l'aide de la mesure donnée. Utlisez pi = 3.14

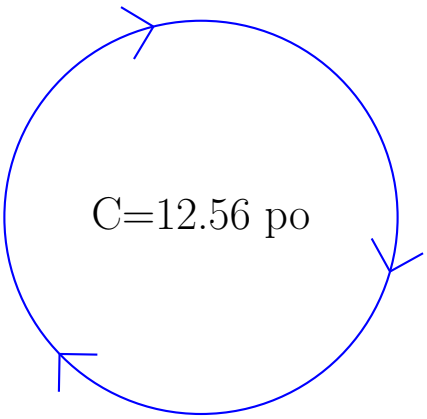

rayon = _____

diamètre = _____

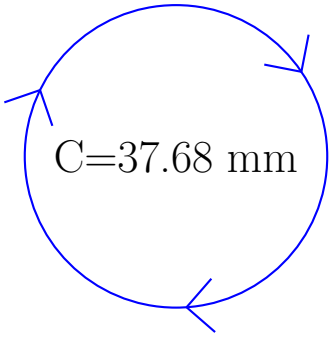

rayon = _____

diamètre = _____

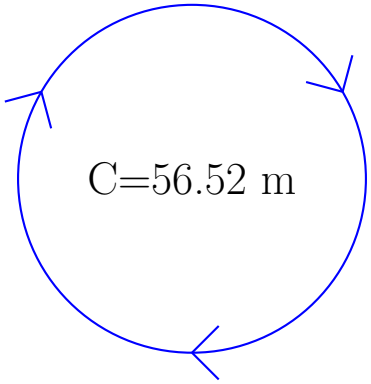

rayon = _____

diamètre = _____

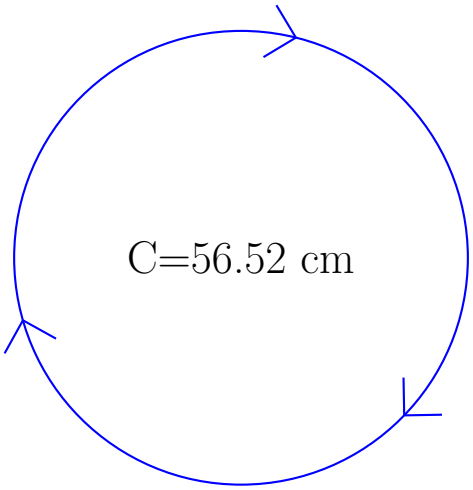

rayon = _____

diamètre = _____

Calcul du Rayon et Diamètre des Cercles (B) Solutions

Calculez les mesures de chaque cercles à l'aide de la mesure donnée. Utlisez pi = 3.14

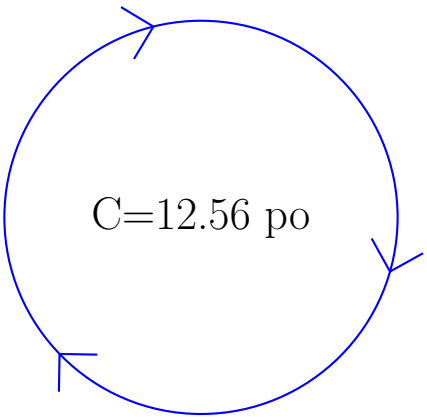

rayon = 2 po

diamètre = 4 po

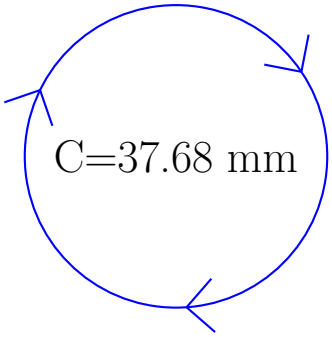

rayon = 6 mm

diamètre = 12 mm

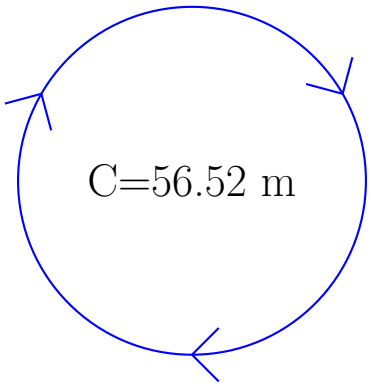

rayon = 9 m

diamètre = 18 m

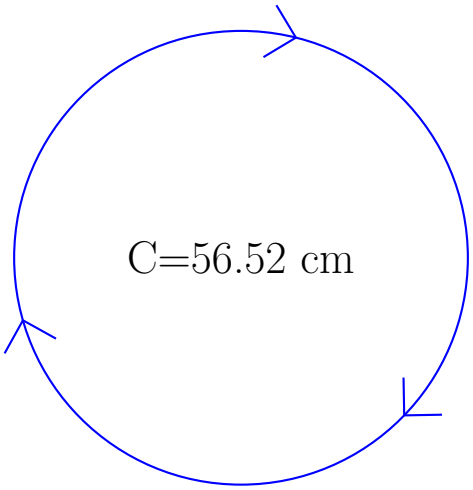

rayon = 9 cm

diamètre = 18 cm