Rapport Trigonométrique Cos (D)

Nom: _____ Date: _____

Trouvez la mesure d'un côté avec le rapport trigonométrique cosinus:

$$cos(\alpha) = \frac{A}{H}$$

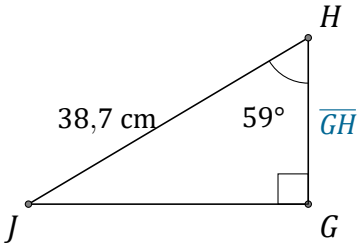

$\overline{GH} =$ _____

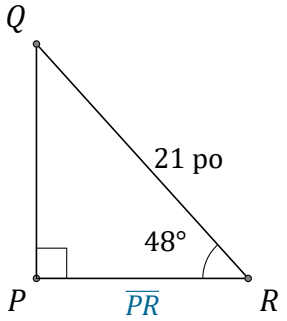

$\overline{PR} =$ _____

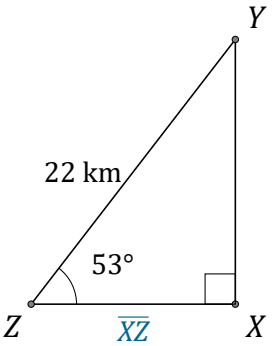

$\overline{XZ} =$ _____

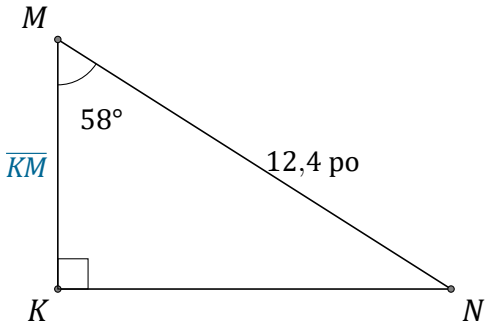

$\overline{KM} =$ _____