Rapport Trigonométrique Tan (D)

Nom: _____ Date: _____

Trouvez la mesure d'un angle ou d'un côté avec le rapport trigonométrique tangente: $tan(\alpha) = \frac{O}{A}$

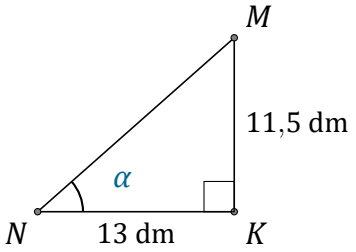

$\alpha = \angle KNM =$ _____

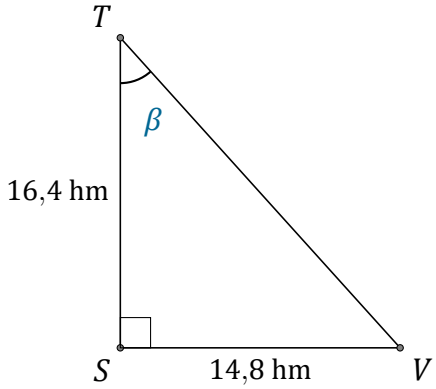

$\beta = \angle STV =$ _____

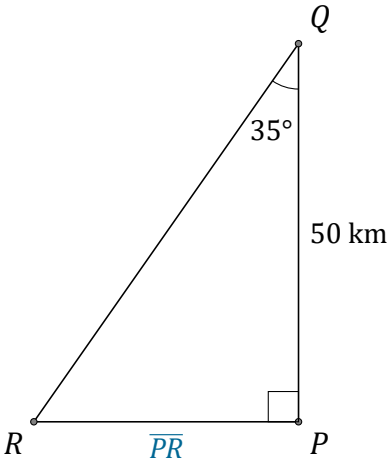

$\overline{PR} =$ _____

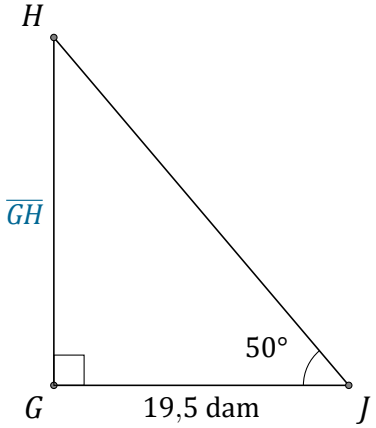

$\overline{GH} =$ _____