Rapport Trigonométrique Sin (E)

Nom: _____ Date: _____

Trouvez la mesure d'un angle ou d'un côté avec le rapport trigonométrique sinus: $sin(\alpha) = \frac{O}{H}$

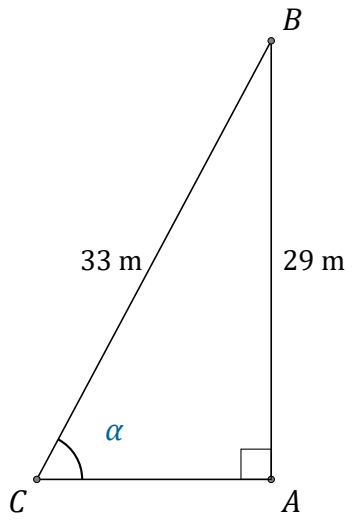

$\alpha = \angle ACB =$ _____

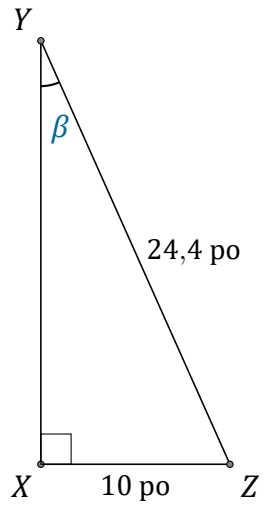

$\beta = \angle XYZ =$ _____

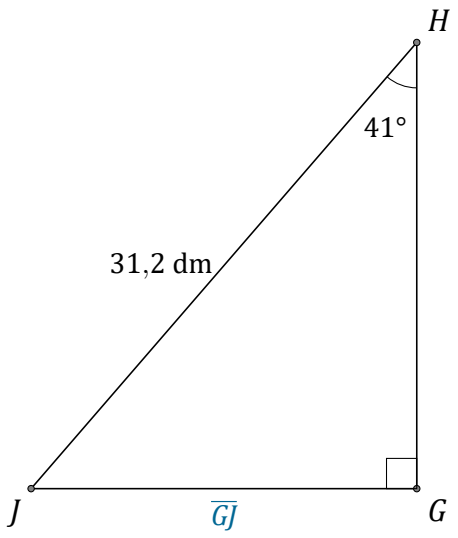

$\overline{GJ} =$ _____

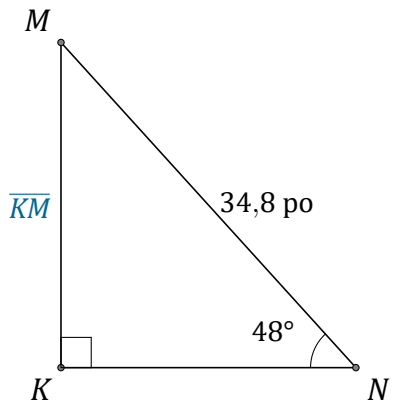

$\overline{KM} =$ _____