Rapport Trigonométrique Sin (C)

Nom: _____ Date: _____

Trouvez la mesure d'un angle ou d'un côté avec le rapport trigonométrique sinus: $sin(\alpha) = \frac{O}{H}$

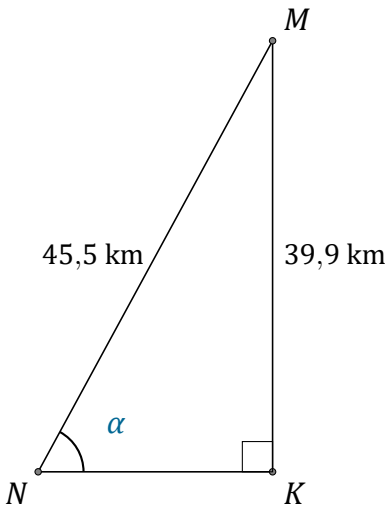

$\alpha = \angle KNM =$ _____

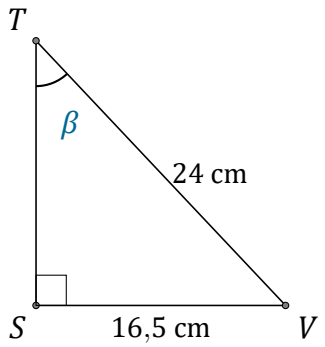

$\beta = \angle STV =$ _____

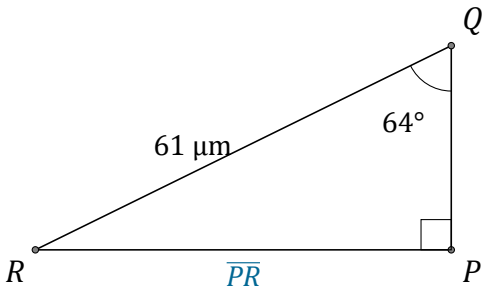

$\overline{PR} =$ _____

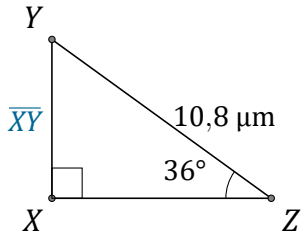

$\overline{XY} =$ _____