Rapports Trigonométriques (I)

Nom: _____ Date: _____

Trouvez la mesure d'un angle ou d'un côté avec les rapports triogonométriques.

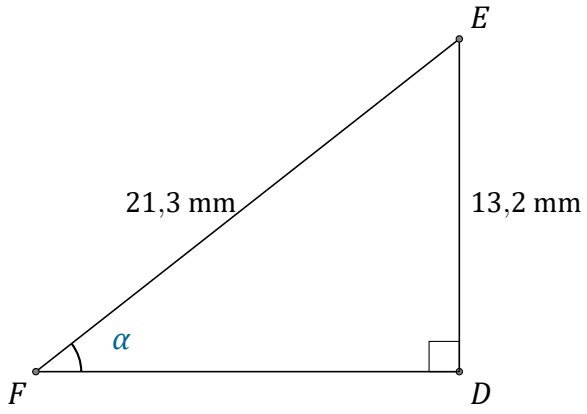

$\alpha = \angle DFE =$ _____

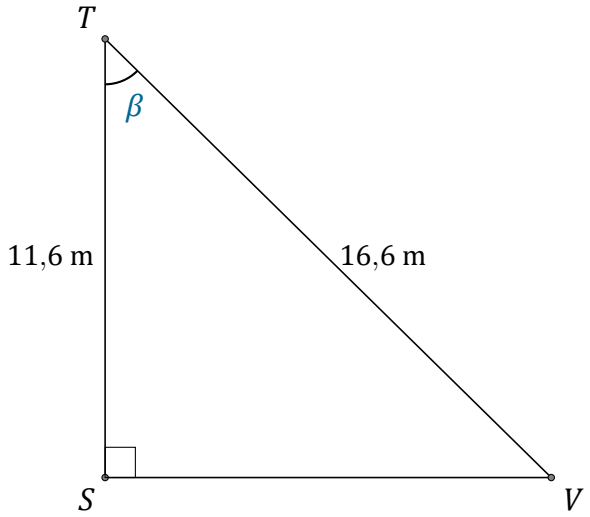

$\beta = \angle STV =$ _____

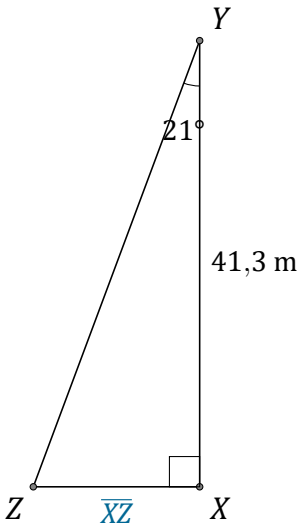

$\overline{XZ} =$ _____

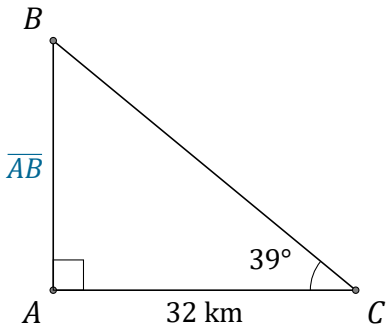

$\overline{AB} =$ _____

Rapports Trigonométriques (I) Réponses

Nom: _____ Date: _____

Trouvez la mesure d'un angle ou d'un côté avec les rapports triogonométriques.

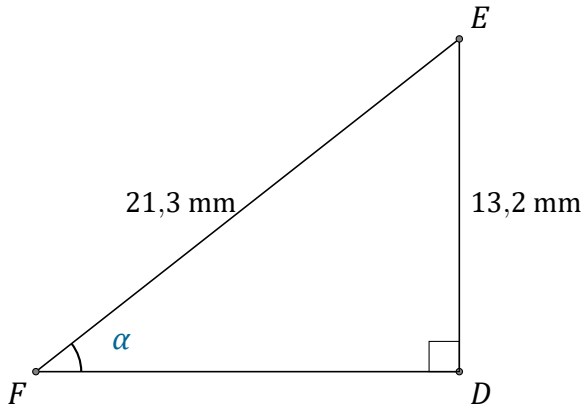

$\alpha = \angle DFE =$ 38,3°

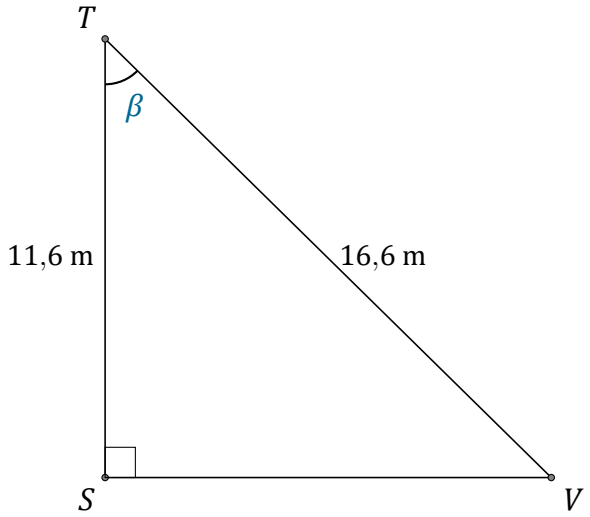

$\beta = \angle STV =$ 45,7°

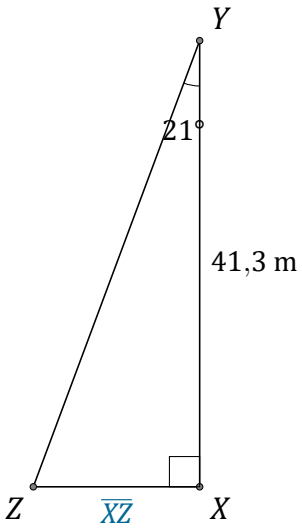

$\overline{XZ} =$ 15,9 m

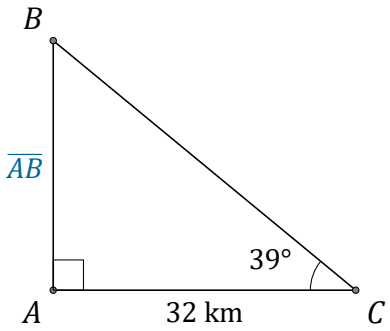

$\overline{AB} =$ 25,9 km