Rapports Trigonométriques (D)

Nom: _____ Date: _____

Trouvez la mesure d'un angle ou d'un côté avec les rapports triogonométriques.

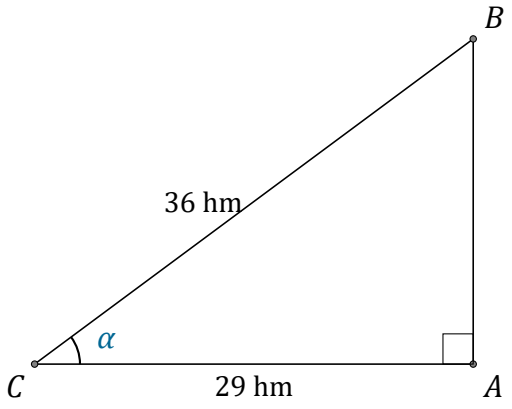

$\alpha = \angle ACB =$ _____

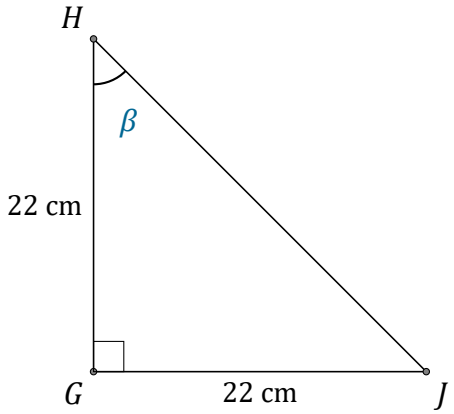

$\beta = \angle GHJ =$ _____

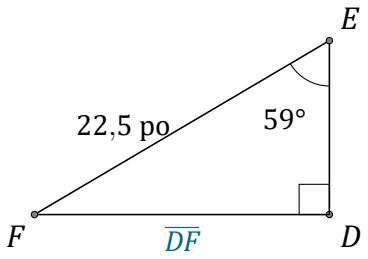

$\overline{DF} =$ _____

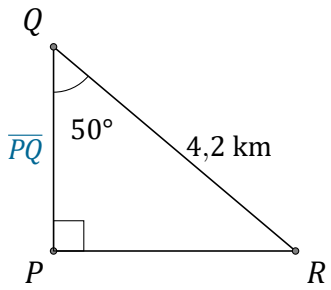

$\overline{PQ} =$ _____