Rapport Trigonométrique Sin (E)

Nom: _____ Date: _____

Trouvez la mesure d'un angle avec le rapport trigonométrique sinus: $sin(\alpha) = \frac{O}{H}$

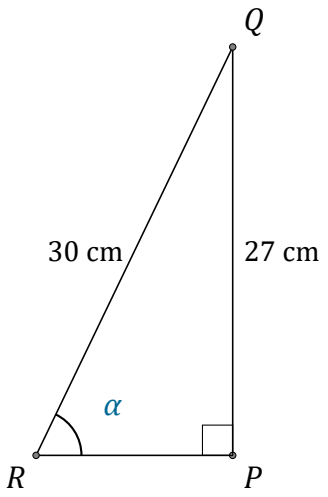

$\alpha = \angle PRQ =$ _____

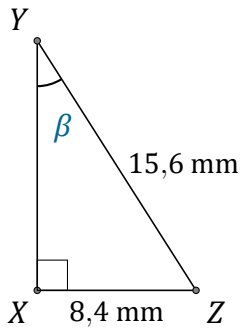

$\beta = \angle XYZ =$ _____

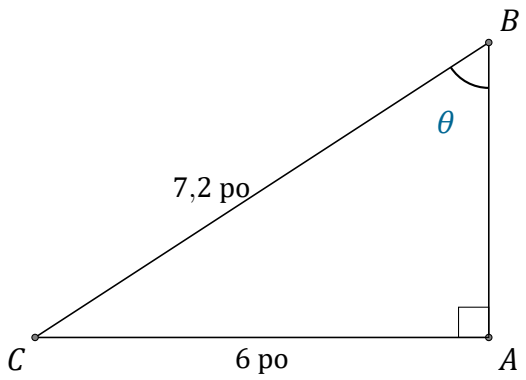

$\theta = \angle ABC =$ _____

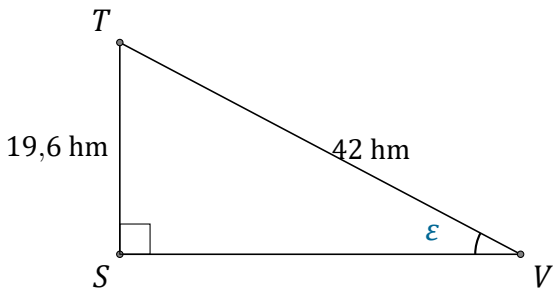

$\varepsilon = \angle SVT =$ _____

Rapport Trigonométrique Sin (E) Réponses

Nom: _____ Date: _____

Trouvez la mesure d'un angle avec le rapport trigonométrique sinus: $sin(\alpha) = \frac{O}{H}$

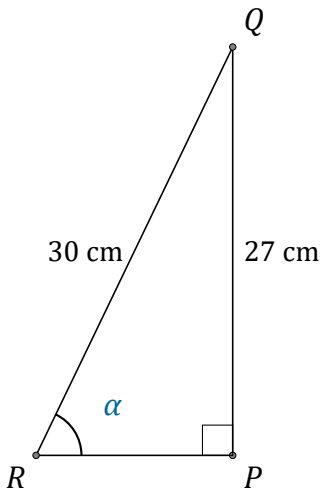

$\alpha = \angle PRQ =$ 64,2°

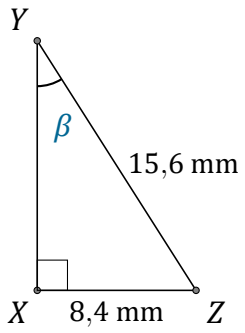

$\beta = \angle XYZ =$ 32,6°

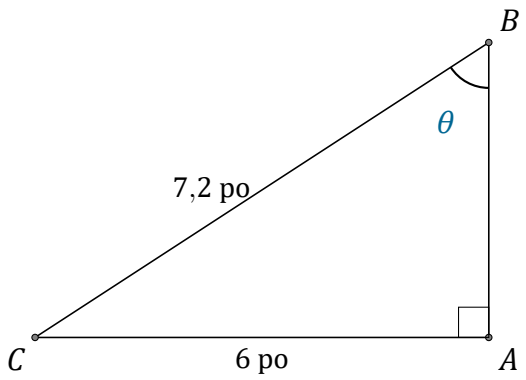

$\theta = \angle ABC =$ 56,4°

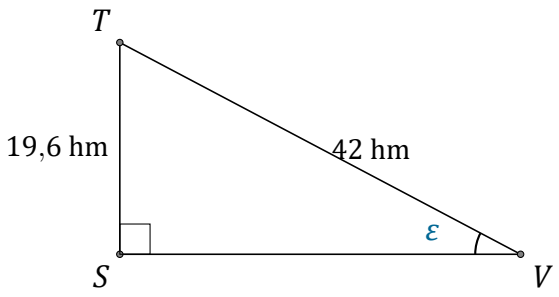

$\varepsilon = \angle SVT =$ 27,8°