Rapport Trigonométrique Sin (D)

Nom: _____ Date: _____

Trouvez la mesure d'un angle avec le rapport trigonométrique sinus: $sin(\alpha) = \frac{O}{H}$

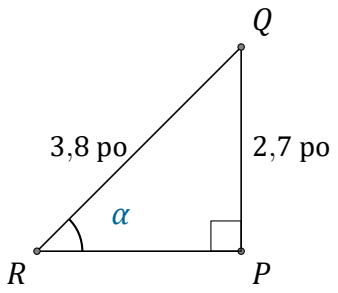

$\alpha = \angle PRQ =$ _____

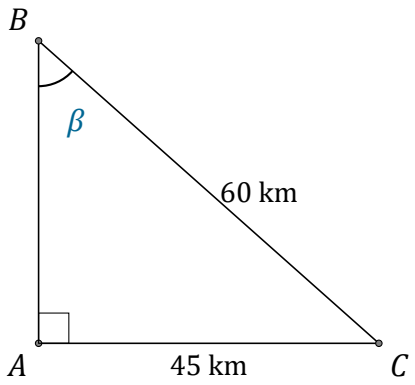

$\beta = \angle ABC =$ _____

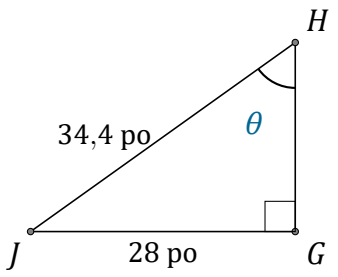

$\theta = \angle GHJ =$ _____

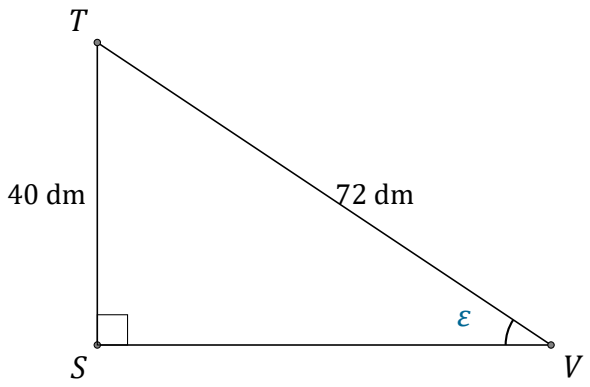

$\varepsilon = \angle SVT =$ _____