Rapport Trigonométrique Sin (B)

Nom: _____ Date: _____

Trouvez la mesure d'un angle avec le rapport trigonométrique sinus: $sin(\alpha) = \frac{O}{H}$

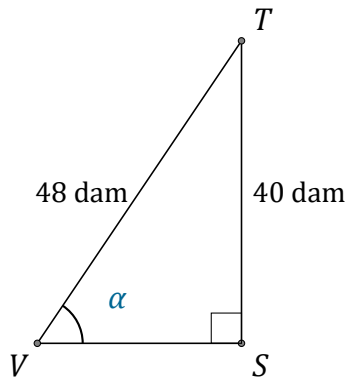

$\alpha = \angle SVT =$ _____

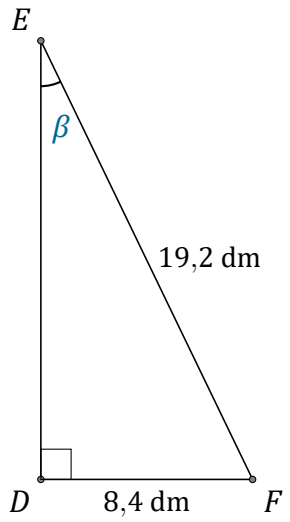

$\beta = \angle DEF =$ _____

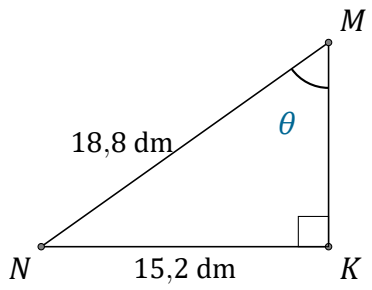

$\theta = \angle KMN =$ _____

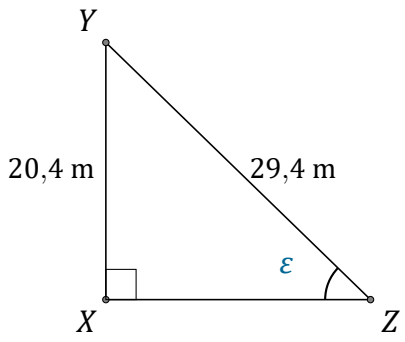

$\varepsilon = \angle XZY =$ _____

Rapport Trigonométrique Sin (B) Réponses

Nom: _____ Date: _____

Trouvez la mesure d'un angle avec le rapport trigonométrique sinus: $sin(\alpha) = \frac{O}{H}$

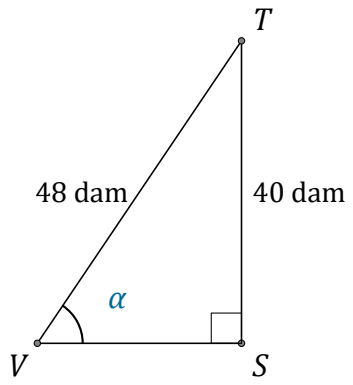

$\alpha = \angle SVT =$ 56,4°

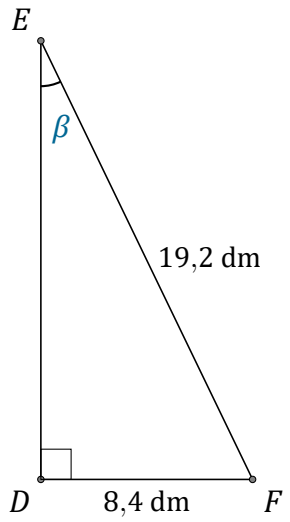

$\beta = \angle DEF =$ 25,9°

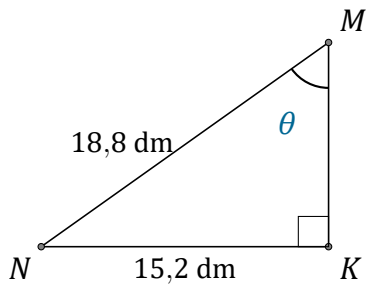

$\theta = \angle KMN =$ 54°

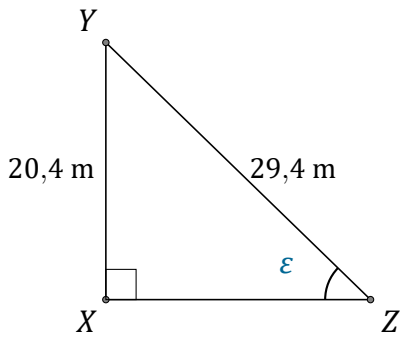

$\varepsilon = \angle XZY =$ 43,9°