Rapports Trigonométriques (J)

Nom: _____ Date: _____

Trouvez la mesure d'un angle avec les rapports triogonométriques

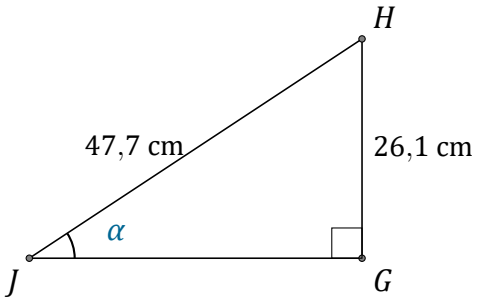

$\alpha = \angle GJH =$ _____

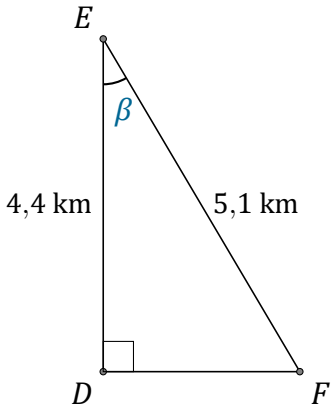

$\beta = \angle DEF =$ _____

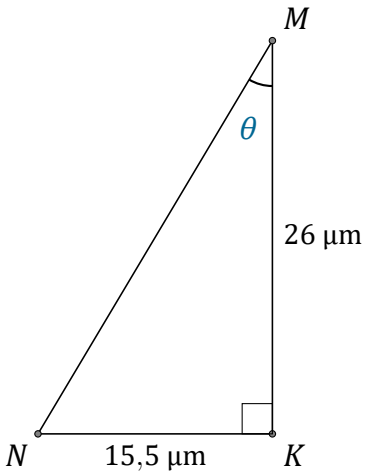

$\theta = \angle KMN =$ _____

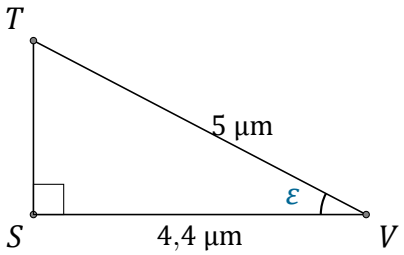

$\varepsilon = \angle SVT =$ _____