Rapports Trigonométriques (H)

Nom: _____ Date: _____

Trouvez la mesure d'un angle avec les rapports triogonométriques

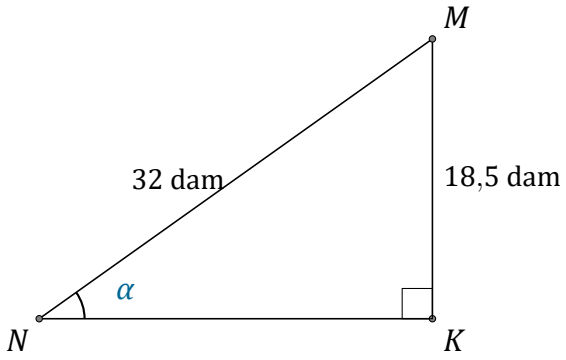

$\alpha = \angle KNM =$ _____

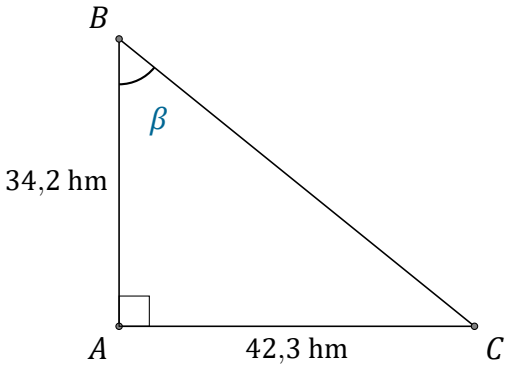

$\beta = \angle ABC =$ _____

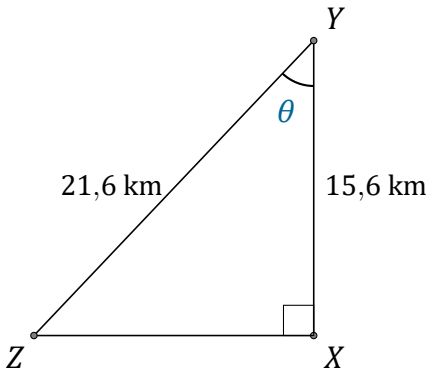

$\theta = \angle XYZ =$ _____

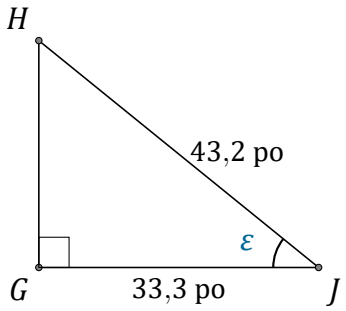

$\varepsilon = \angle GJH =$ _____

Rapports Trigonométriques (H) Réponses

Nom: _____ Date: _____

Trouvez la mesure d'un angle avec les rapports triogonométriques

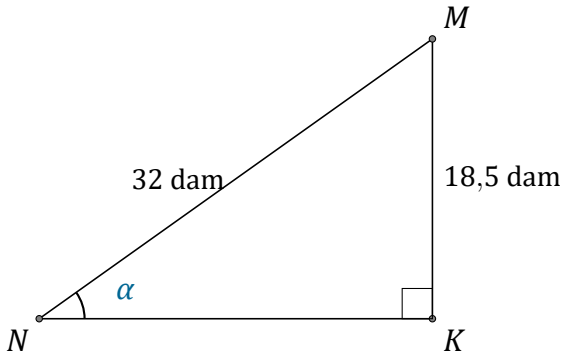

$\alpha = \angle KNM =$ 35,3°

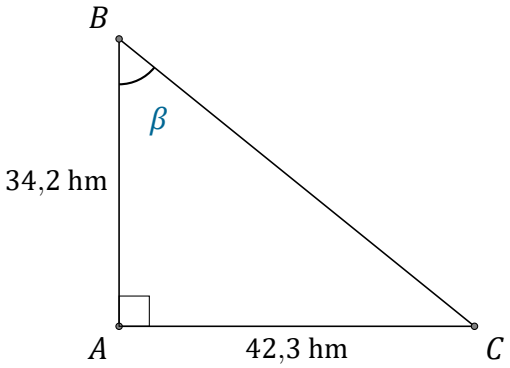

$\beta = \angle ABC =$ 51°

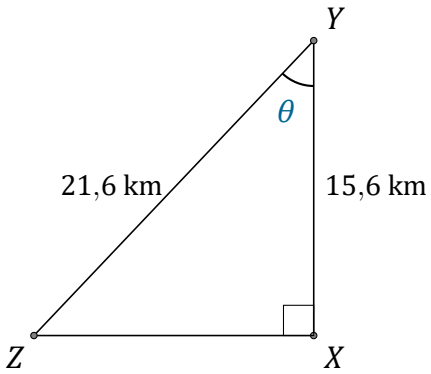

$\theta = \angle XYZ =$ 43,8°

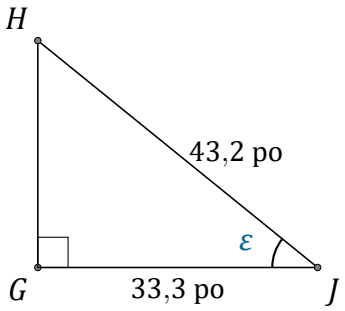

$\varepsilon = \angle GJH =$ 39,6°