Rapport Trigonométrique Cos (D)

Nom: _____ Date: _____

Trouvez la mesure d'un angle avec le rapport trigonométrique cosinus:

$$cos(\alpha) = \frac{A}{H}$$

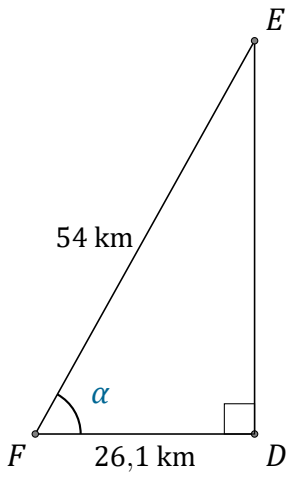

$\alpha = \angle DFE =$ _____

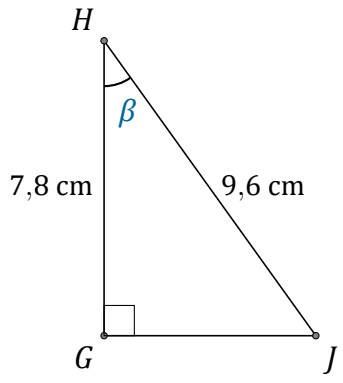

$\beta = \angle GHJ =$ _____

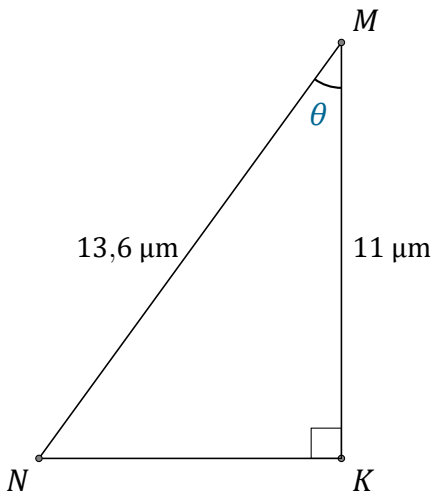

$\theta = \angle KMN =$ _____

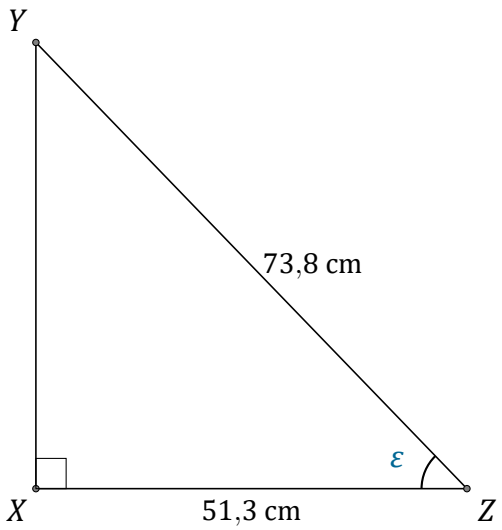

$\varepsilon = \angle XZY =$ _____