# Calcul de l'Aire et Circonférence (B)

Calculez les mesures de chaque cercles à l'aide de la mesure donnée. Utlisez pi = 3.14

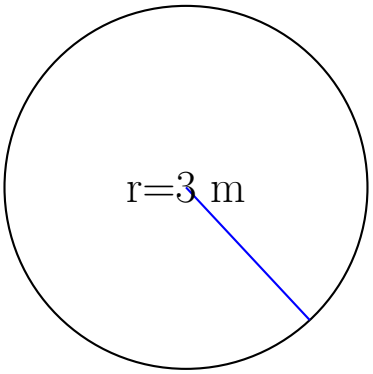


circonférence = _____

aire = _____

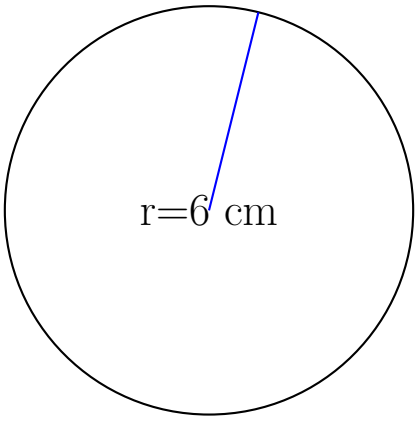


circonférence = _____

aire = _____

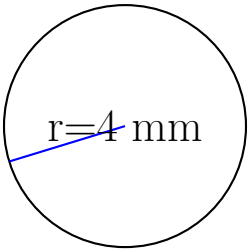


circonférence = _____

aire = _____

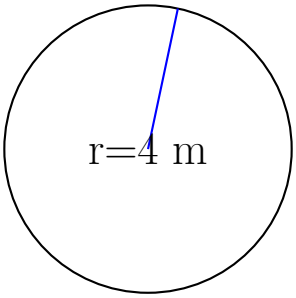


circonférence = _____

aire = _____